Math Practice - PreK

PM-9 Sort, match, and make patterns - Sort and count

PM-9 IELDS 8.A.ECa, 8.A.ECb, 8.B.ECa

Name: _____ Date: _____

Count the circles in each row. Write how many in the box.

Example: Count the red circles and the blue circles.

How: Count the circles in the top row and the circles in the bottom row. Write each number in its box.

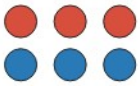

Red: 3

Blue: 3

1

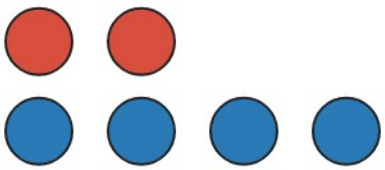

Red: ☐

Blue: ☐

2

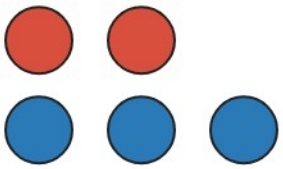

Red: ☐

Blue: ☐

3

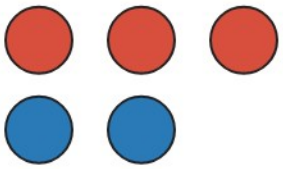

Red: ☐

Blue: ☐

4

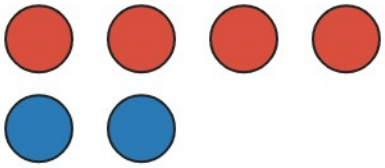

Red: ☐

Blue: ☐

Math Practice - PreK

PM-9 Sort, match, and make patterns - Sort and count

PM-9 IELDS 8.A.ECa, 8.A.ECb, 8.B.ECa

Name: _____ Date: _____

Count the circles in each row. Write how many in the box.

Example: Count the red circles and the blue circles.

How: Count the circles in the top row and the circles in the bottom row. Write each number in its box.

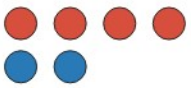

Red: 4

Blue: 2

1

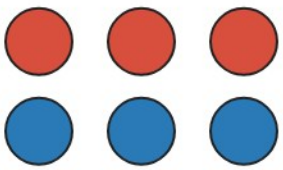

Red: ☐

Blue: ☐

2

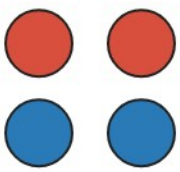

Red: ☐

Blue: ☐

3

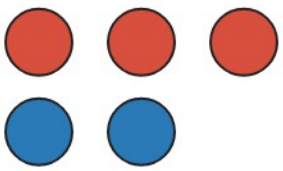

Red: ☐

Blue: ☐

4

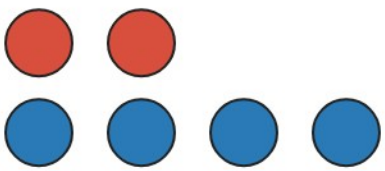

Red: ☐

Blue: ☐

Math Practice - PreK

PM-9 Sort, match, and make patterns - Sort and count

PM-9 IELDS 8.A.ECa, 8.A.ECb, 8.B.ECa

Name: _____ Date: _____

Count the circles in each row. Write how many in the box.

Example: Count the red circles and the blue circles.

How: Count the circles in the top row and the circles in the bottom row. Write each number in its box.

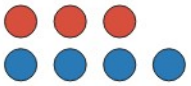

Red: 3

Blue: 4

1

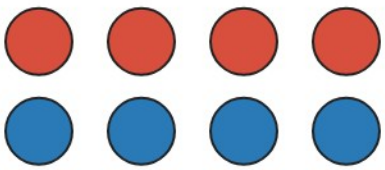

Red: ☐

Blue: ☐

2

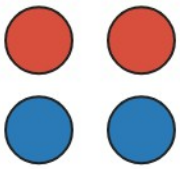

Red: ☐

Blue: ☐

3

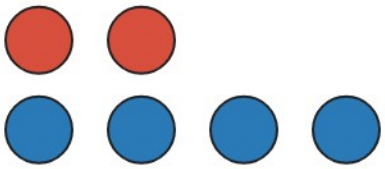

Red: ☐

Blue: ☐

4

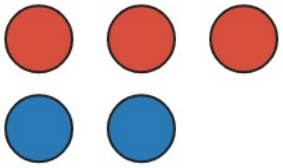

Red: ☐

Blue: ☐