Math Practice - PreK

PM-7 Longer, taller, heavier, bigger - Taller

PM-7 IELDS 7.A.ECa, 7.A.ECb, 7.A.ECc, 7.B.ECa, 7.C.ECa, 7.C.ECb

Name: _____ Date: _____

Circle the taller bar.

Example: Circle the taller bar.

How: Both bars start on the same line. The bar that goes higher is the taller one.



Answer: Right

1



2



3



4



Math Practice - PreK

PM-7 Longer, taller, heavier, bigger - Taller

PM-7 IELDS 7.A.ECa, 7.A.ECb, 7.A.ECc, 7.B.ECa, 7.C.ECa, 7.C.ECb

Name: _____ Date: _____

Circle the taller bar.

Example: Circle the taller bar.

How: Both bars start on the same line. The bar that goes higher is the taller one.



Answer: Right

1



2



3



4



Math Practice - PreK

PM-7 Longer, taller, heavier, bigger - Taller

PM-7 IELDS 7.A.ECa, 7.A.ECb, 7.A.ECc, 7.B.ECa, 7.C.ECa, 7.C.ECb

Name: _____ Date: _____

Circle the taller bar.

Example: Circle the taller bar.

How: Both bars start on the same line. The bar that goes higher is the taller one.



Answer: Right

1



2



3



4

