Math Practice - PreK

PM-7 Longer, taller, heavier, bigger - Heavier

PM-7 IELDS 7.A.ECa, 7.A.ECb, 7.A.ECc, 7.B.ECa, 7.C.ECa, 7.C.ECb

Name: _____ Date: _____

Circle the heavier one.

Example: Circle the heavier one.

How: Think about real life. The object that is harder to lift is the heavier one.

Answer: Car



Left
Car



Right
Bicycle

1



Left
Elephant



Right
Mouse

2



Left
Feather

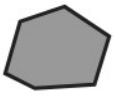

Right
Rock

3



Left
Backpack



Right
Pencil

4



Left
Brick



Right
Balloon

Math Practice - PreK

PM-7 Longer, taller, heavier, bigger - Heavier

PM-7 IELDS 7.A.ECa, 7.A.ECb, 7.A.ECc, 7.B.ECa, 7.C.ECa, 7.C.ECb

Name: _____ Date: _____

Circle the heavier one.

Example: Circle the heavier one.

How: Think about real life. The object that is harder to lift is the heavier one.

Answer: Rock



Left
Feather



Right
Rock

1



Left
Balloon



Right
Brick

2



Left
Elephant



Right
Mouse

3



Left
Bicycle



Right
Car

4



Left
Pencil



Right
Backpack

Math Practice - PreK

PM-7 Longer, taller, heavier, bigger - Heavier

PM-7 IELDS 7.A.ECa, 7.A.ECb, 7.A.ECc, 7.B.ECa, 7.C.ECa, 7.C.ECb

Name: _____ Date: _____

Circle the heavier one.

Example: Circle the heavier one.

How: Think about real life. The object that is harder to lift is the heavier one.

Answer: Brick



Left
Brick



Right
Balloon

1



Left
Feather

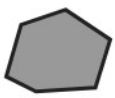

Right
Rock

2



Left
Mouse



Right
Elephant

3



Left
Apple



Right
Watermelon

4



Left
Car



Right
Bicycle