# Math Practice - PreK

## PM-5 Share fairly - Is the sharing fair

PM-5 IELDS 6.B.ECe

Name: _____ Date: _____

Is the sharing fair? Circle Yes or No.

**Example: Is the sharing fair? Circle Yes or No.**

How: Count the treats on each plate. If both plates have the same number, the sharing is fair, so circle Yes.

Answer: No

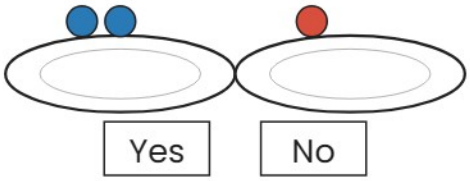


---

**1**



Yes No

---

**2**



Yes No

---

**3**



Yes No

# Math Practice - PreK

## PM-5 Share fairly - Is the sharing fair

PM-5 IELDS 6.B.ECe

Name: _____ Date: _____

Is the sharing fair? Circle Yes or No.

**Example: Is the sharing fair? Circle Yes or No.**

How: Count the treats on each plate. If both plates have the same number, the sharing is fair, so circle Yes.

Answer: Yes

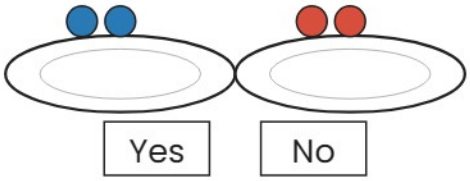


---

**1**



Yes No

---

**2**



Yes No

---

**3**



Yes No

# Math Practice - PreK

## PM-5 Share fairly - Is the sharing fair

PM-5 IELDS 6.B.ECe

Name: _____ Date: _____

Is the sharing fair? Circle Yes or No.

**Example: Is the sharing fair? Circle Yes or No.**

How: Count the treats on each plate. If both plates have the same number, the sharing is fair, so circle Yes.

Answer: Yes

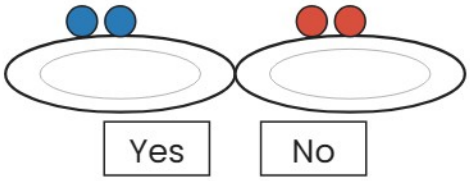

Yes No

---

**1**



Yes No

---

**2**



Yes No

---

**3**



Yes No