Math Practice - PreK

PM-5 Share fairly - Draw the same number on each plate

PM-5 IELDS 6.B.ECe

Name: _____ Date: _____

Share the treats fairly. Draw the same number on each plate.

Example: Share fairly. Draw the same number on each plate.

How: Count the treats, then split them in half. Each plate gets the same number.

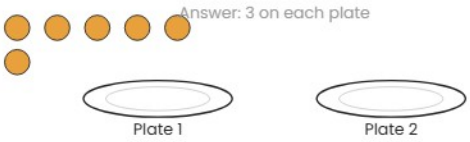

1

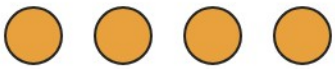


Plate 1

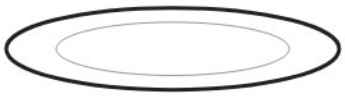
Plate 2

2

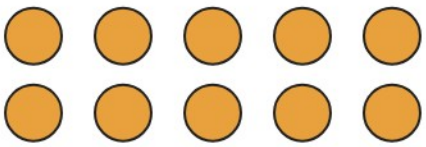


Plate 1

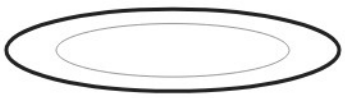
Plate 2

3

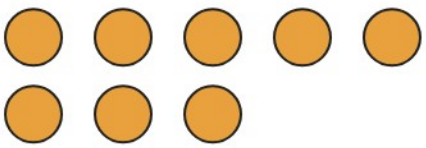


Plate 1


Plate 2

Math Practice - PreK

PM-5 Share fairly - Draw the same number on each plate

PM-5 IELDS 6.B.ECe

Name: _____ Date: _____

Share the treats fairly. Draw the same number on each plate.

Example: Share fairly. Draw the same number on each plate.

How: Count the treats, then split them in half. Each plate gets the same number.

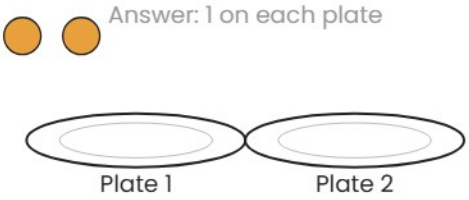

1

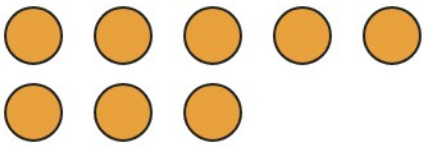



Plate 1

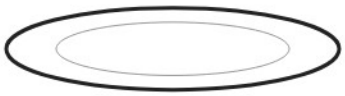

Plate 2

2

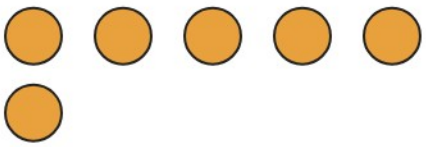



Plate 1

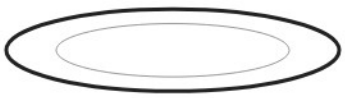

Plate 2

3

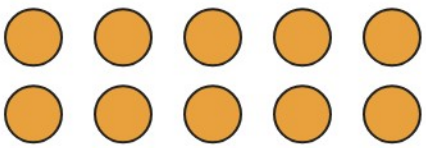



Plate 1



Plate 2

Math Practice - PreK

PM-5 Share fairly - Draw the same number on each plate

PM-5 IELDS 6.B.ECe

Name: _____ Date: _____

Share the treats fairly. Draw the same number on each plate.

Example: Share fairly. Draw the same number on each plate.

How: Count the treats, then split them in half. Each plate gets the same number.

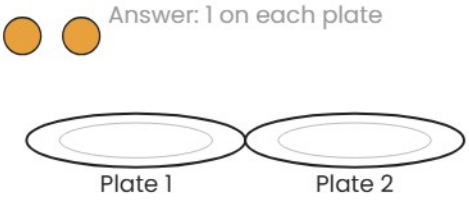

1

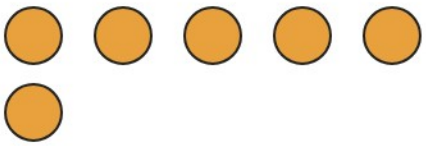



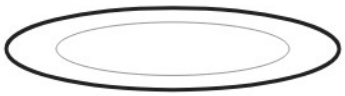

2

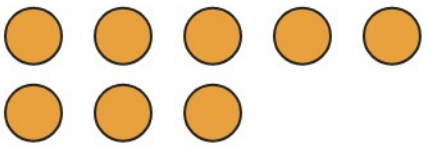



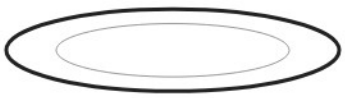

3

