Math Practice - PreK

PM-2 How many? Zero, more, less, same - Same

PM-2 IELDS 6.A.ECc, 6.D.ECa, 6.D.ECb

Name: _____ Date: _____

Circle Yes if the groups are the same.

Example: Circle Yes if the groups are the same.

How: Count both groups. If the numbers match, the groups are the same, so circle Yes.

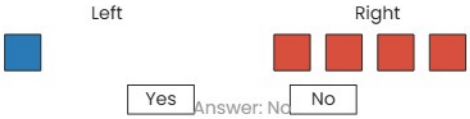

1

Left

Right

Yes

No

2

Left

Right

Yes

No

3

Left

Right

Yes

No

4

Left

Right

Yes

No

5

Left

Right

Yes

No

Math Practice - PreK

PM-2 How many? Zero, more, less, same - Same

PM-2 IELDS 6.A.ECc, 6.D.ECa, 6.D.ECb

Name: _____ Date: _____

Circle Yes if the groups are the same.

Example: Circle Yes if the groups are the same.

How: Count both groups. If the numbers match, the groups are the same, so circle Yes.

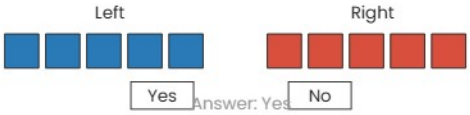

1

Left

Right

Yes

No

2

Left

Right

Yes

No

3

Left

Right

Yes

No

4

Left

Right

Yes

No

5

Left

Right

Yes

No

Math Practice - PreK

PM-2 How many? Zero, more, less, same - Same

PM-2 IELDS 6.A.ECc, 6.D.ECa, 6.D.ECb

Name: _____ Date: _____

Circle Yes if the groups are the same.

Example: Circle Yes if the groups are the same.

How: Count both groups. If the numbers match, the groups are the same, so circle Yes.

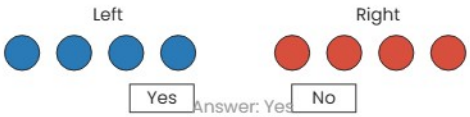

1



2

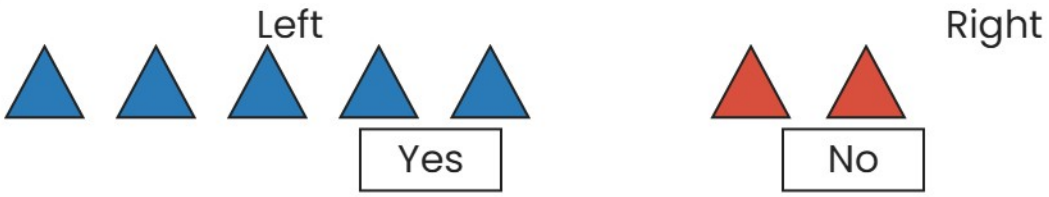

3



4



5

