Math Practice - PreK

PM-2 How many? Zero, more, less, same - Fewer

PM-2 IELDS 6.A.ECc, 6.D.ECa, 6.D.ECb

Name: _____ Date: _____

Circle the group with fewer.

Example: Circle the group with fewer.

How: Count both groups. The group with the smaller number has fewer.



Answer: Right

1

Left



Right



2

Left



Right

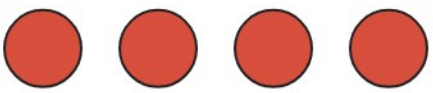

3

Left



Right



4

Left



Right



5

Left



Right

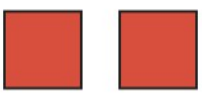

Math Practice - PreK

PM-2 How many? Zero, more, less, same - Fewer

PM-2 IELDS 6.A.ECc, 6.D.ECa, 6.D.ECb

Name: _____ Date: _____

Circle the group with fewer.

Example: Circle the group with fewer.

How: Count both groups. The group with the smaller number has fewer.



Answer: Right

1

Left



Right

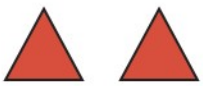

2

Left



Right



3

Left



Right



4

Left



Right

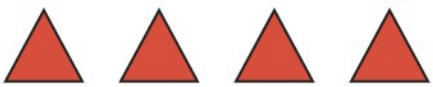

5

Left



Right



Math Practice - PreK

PM-2 How many? Zero, more, less, same - Fewer

PM-2 IELDS 6.A.ECc, 6.D.ECa, 6.D.ECb

Name: _____ Date: _____

Circle the group with fewer.

Example: Circle the group with fewer.

How: Count both groups. The group with the smaller number has fewer.



Answer: Right

1

Left Right



2

Left Right



3

Left Right



4

Left Right



5

Left Right

