Math Practice - PreK

PM-12 Ask, count, and tell - Which has the most

PM-12 IELDS 10.A.ECa, 10.A.ECb, 10.B.ECa, 10.B.ECb, 10.C.ECa

Name: _____ Date: _____

Count the pictures. Which has the most?

Example: Count the pictures. Which has the most?

How: Count the pictures in each column. The column with the biggest number has the most.

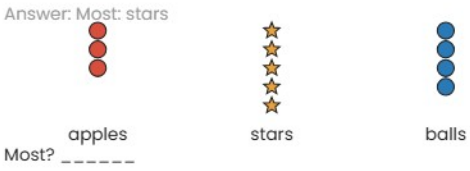

1



apples stars balls

Most? _____

2



apples stars balls

Most? _____

3



apples stars balls

Most? _____

Math Practice - PreK

PM-12 Ask, count, and tell - Which has the most

PM-12 IELDS 10.A.ECa, 10.A.ECb, 10.B.ECa, 10.B.ECb, 10.C.ECa

Name: _____ Date: _____

Count the pictures. Which has the most?

Example: Count the pictures. Which has the most?

How: Count the pictures in each column. The column with the biggest number has the most.

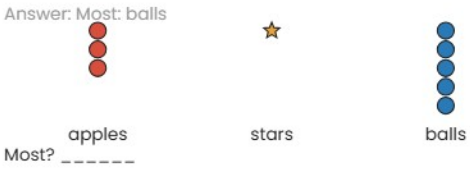

1



apples stars balls

Most? _____

2



apples stars balls

Most? _____

3



apples stars balls

Most? _____

Math Practice - PreK

PM-12 Ask, count, and tell - Which has the most

PM-12 IELDS 10.A.ECa, 10.A.ECb, 10.B.ECa, 10.B.ECb, 10.C.ECa

Name: _____ Date: _____

Count the pictures. Which has the most?

Example: Count the pictures. Which has the most?

How: Count the pictures in each column. The column with the biggest number has the most.

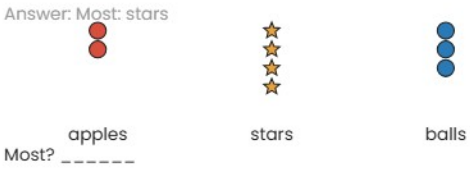

1



apples stars balls

Most? _____

2



apples stars balls

Most? _____

3



apples stars balls

Most? _____