# Math Practice - PreK

## PM-10 Shapes around me - Name the shape

PM-10 IELDS 9.A.ECa, 9.A.ECb, 9.A.ECc, 9.A.ECd, 9.A.ECe

Name: _____ Date: _____

What shape is this? Say its name.

**Example: What shape is this?**

How: Count the sides and corners. A shape with 3 sides is a triangle, 4 sides is a square or rectangle, and no sides is a circle.



Shape: _____

Answer: star

---

**1**

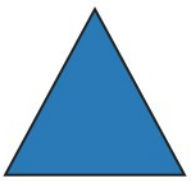

Shape: _____

---

**2**

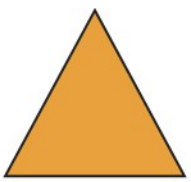

Shape: _____

---

**3**



Shape: _____

---

**4**



Shape: _____

# Math Practice - PreK

## PM-10 Shapes around me - Name the shape

PM-10 IELDS 9.A.ECa, 9.A.ECb, 9.A.ECc, 9.A.ECd, 9.A.ECe

Name: _____ Date: _____

What shape is this? Say its name.

**Example: What shape is this?**

How: Count the sides and corners. A shape with 3 sides is a triangle, 4 sides is a square or rectangle, and no sides is a circle.



Shape: _____

Answer: star

---

**1**



Shape: _____

---

**2**



Shape: _____

---

**3**



Shape: _____

---

**4**



Shape: _____

# Math Practice - PreK

## PM-10 Shapes around me - Name the shape

PM-10 IELDS 9.A.ECa, 9.A.ECb, 9.A.ECc, 9.A.ECd, 9.A.ECe

Name: _____ Date: _____

What shape is this? Say its name.

**Example: What shape is this?**

How: Count the sides and corners. A shape with 3 sides is a triangle, 4 sides is a square or rectangle, and no sides is a circle.



Shape: _____

Answer: circle

---

**1**

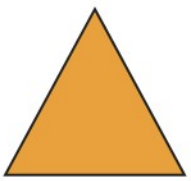

Shape: _____

---

**2**

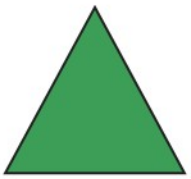

Shape: _____

---

**3**



Shape: _____

---

**4**



Shape: _____