Math Practice - PreK

PM-10 Shapes around me - Count the sides

PM-10 IELDS 9.A.ECa, 9.A.ECb, 9.A.ECc, 9.A.ECd, 9.A.ECe

Name: _____ Date: _____

How many sides does this shape have?

Example: How many sides does this shape have?

How: Count the straight edges around the shape. Each edge is one side.



Sides: 4

1

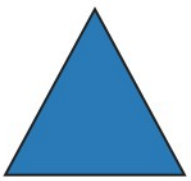

Sides: ☐

2



Sides: ☐

3



Sides: ☐

4



Sides: ☐

Math Practice - PreK

PM-10 Shapes around me - Count the sides

PM-10 IELDS 9.A.ECa, 9.A.ECb, 9.A.ECc, 9.A.ECd, 9.A.ECe

Name: _____ Date: _____

How many sides does this shape have?

Example: How many sides does this shape have?

How: Count the straight edges around the shape. Each edge is one side.

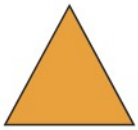

Sides: 3

1



Sides: ☐

2



Sides: ☐

3



Sides: ☐

4

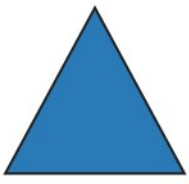

Sides: ☐

Math Practice - PreK

PM-10 Shapes around me - Count the sides

PM-10 IELDS 9.A.ECa, 9.A.ECb, 9.A.ECc, 9.A.ECd, 9.A.ECe

Name: _____ Date: _____

How many sides does this shape have?

Example: How many sides does this shape have?

How: Count the straight edges around the shape. Each edge is one side.

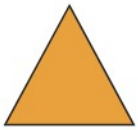

Sides: 3

1



Sides: ☐

2



Sides: ☐

3



Sides: ☐

4



Sides: ☐