Math Practice - PreK

PM-1 Count and say numbers 1 to 5 - Count scattered shapes

PM-1 IELDS 6.A.ECa, 6.A.ECb, 6.A.ECd

Name: _____ Date: _____

Count the shapes. Write the number in the box.

Example: Count the triangles.

How: Count the shapes one by one. The last number you say is how many there are.



3

1



2



3



4

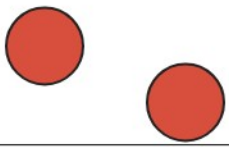

5

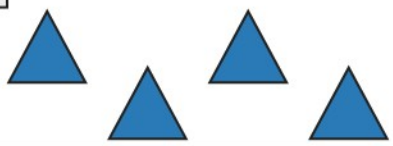

6

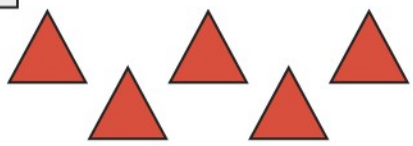

7

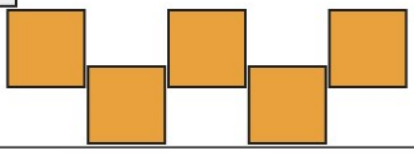

8



9

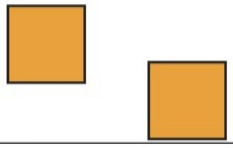

10



11



12

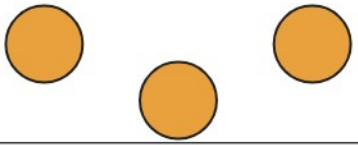

13



14

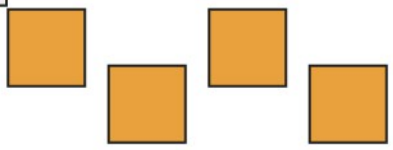

Math Practice - PreK

PM-1 Count and say numbers 1 to 5 - Count scattered shapes

PM-1 IELDS 6.A.ECa, 6.A.ECb, 6.A.ECd

Name: _____ Date: _____

Count the shapes. Write the number in the box.

Example: Count the squares.

How: Count the shapes one by one. The last number you say is how many there are.



1

1



2

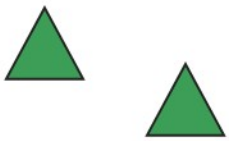

3



4



5

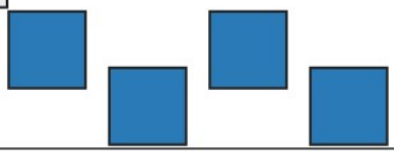

6



7

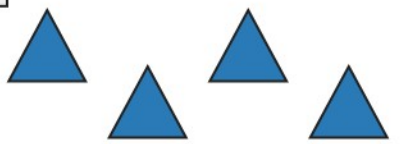

8



9

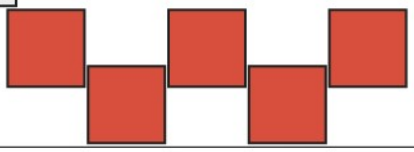

10

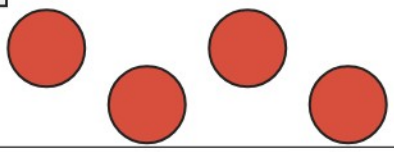

11



12

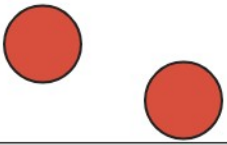

13



14



Math Practice - PreK

PM-1 Count and say numbers 1 to 5 - Count scattered shapes

PM-1 IELDS 6.A.ECa, 6.A.ECb, 6.A.ECd

Name: _____ Date: _____

Count the shapes. Write the number in the box.

Example: Count the stars.

How: Count the shapes one by one. The last number you say is how many there are.



2

1



2



3

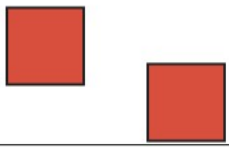

4

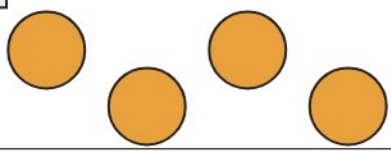

5

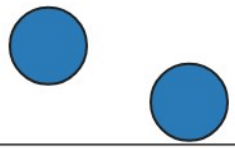

6



7

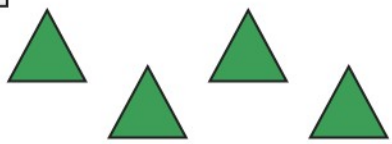

8



9



10

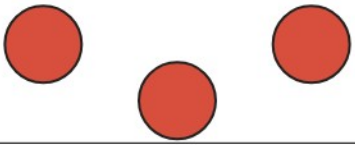

11

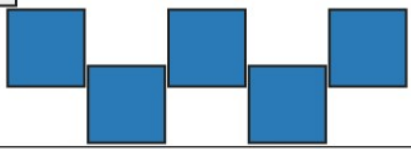

12



13

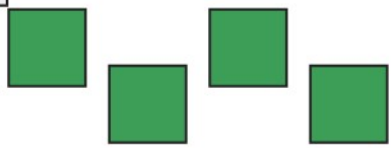

14

