Math Practice - Kindergarten

M-K8 Shapes, 2D, 3D, positions, composing - Name the shape

M-K8 K.G.1, K.G.2, K.G.3, K.G.4, K.G.5, K.G.6

Name: _____ Date: _____

What shape is this? Say its name.

Example: What shape is this?

How: Count the sides and corners. A shape with 3 sides is a triangle, 4 sides is a square or rectangle, 6 sides is a hexagon, and no sides is a circle.



Shape: _____

Answer: cube

1

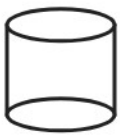

Shape: _____

2



Shape: _____

3

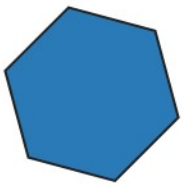

Shape: _____

4



Shape: _____

Math Practice - Kindergarten

M-K8 Shapes, 2D, 3D, positions, composing - Name the shape

M-K8 K.G.1, K.G.2, K.G.3, K.G.4, K.G.5, K.G.6

Name: _____ Date: _____

What shape is this? Say its name.

Example: What shape is this?

How: Count the sides and corners. A shape with 3 sides is a triangle, 4 sides is a square or rectangle, 6 sides is a hexagon, and no sides is a circle.



Shape: _____

Answer: cone

1



Shape: _____

2



Shape: _____

3

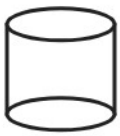

Shape: _____

4



Shape: _____

Math Practice - Kindergarten

M-K8 Shapes, 2D, 3D, positions, composing - Name the shape

M-K8 K.G.1, K.G.2, K.G.3, K.G.4, K.G.5, K.G.6

Name: _____ Date: _____

What shape is this? Say its name.

Example: What shape is this?

How: Count the sides and corners. A shape with 3 sides is a triangle, 4 sides is a square or rectangle, 6 sides is a hexagon, and no sides is a circle.



Shape: _____

Answer: cone

1

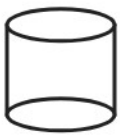

Shape: _____

2



Shape: _____

3

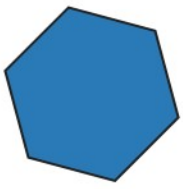

Shape: _____

4



Shape: _____