Math Practice - Kindergarten

M-K8 Shapes, 2D, 3D, positions, composing - Make a shape

M-K8 K.G.1, K.G.2, K.G.3, K.G.4, K.G.5, K.G.6

Name: _____ Date: _____

Which two shapes make the shape? Circle A, B, or C.

Example: Which two shapes make the triangle?

How: Put the two small shapes together in your head. The sides that touch disappear, and the outside edge is the new shape.

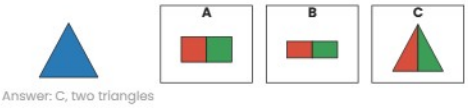

Answer: C, two triangles

1

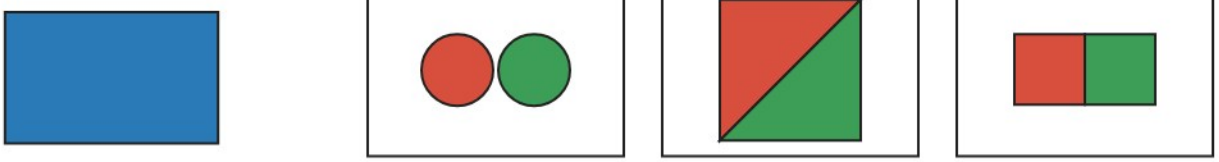

2

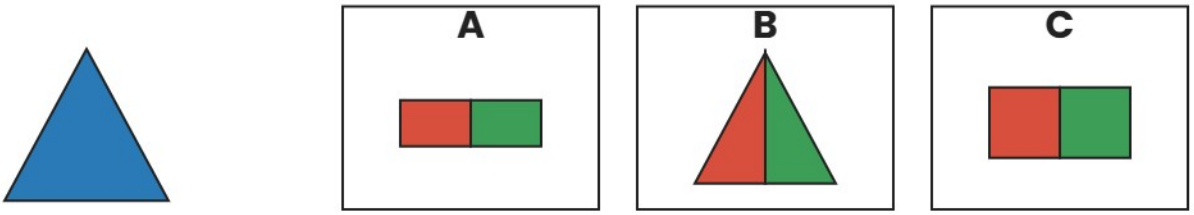

3

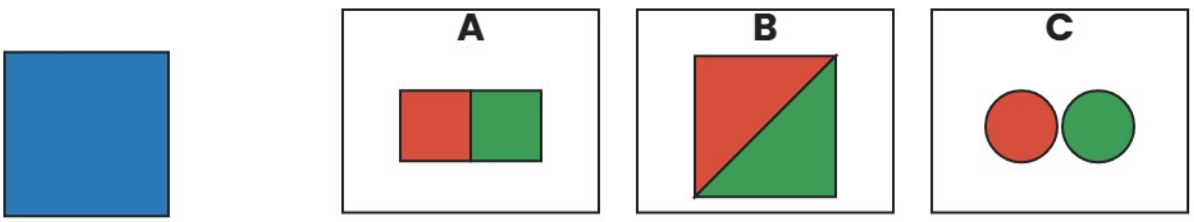

4

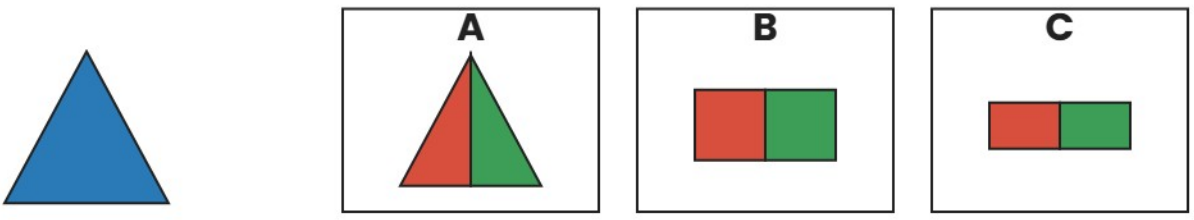

Math Practice - Kindergarten

M-K8 Shapes, 2D, 3D, positions, composing - Make a shape

M-K8 K.G.1, K.G.2, K.G.3, K.G.4, K.G.5, K.G.6

Name: _____ Date: _____

Which two shapes make the shape? Circle A, B, or C.

Example: Which two shapes make the rectangle?

How: Put the two small shapes together in your head. The sides that touch disappear, and the outside edge is the new shape.

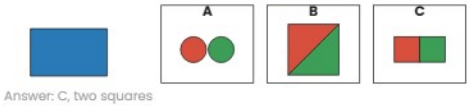

Answer: C, two squares

1

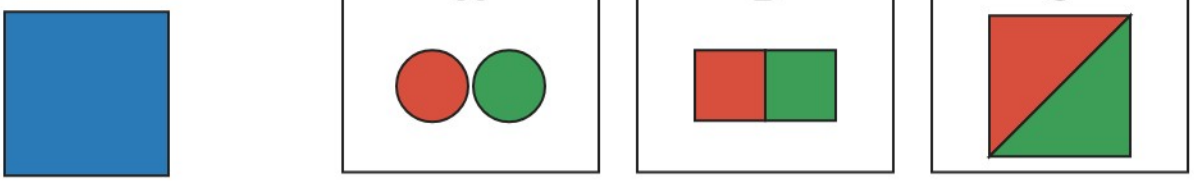

2

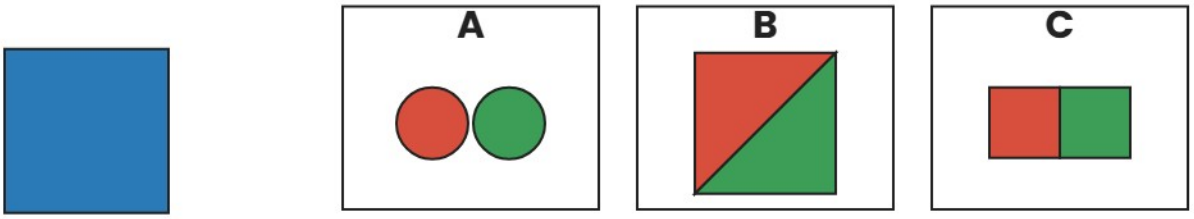

3

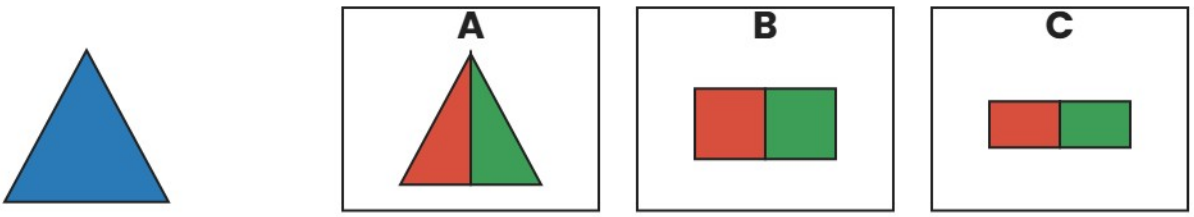

4

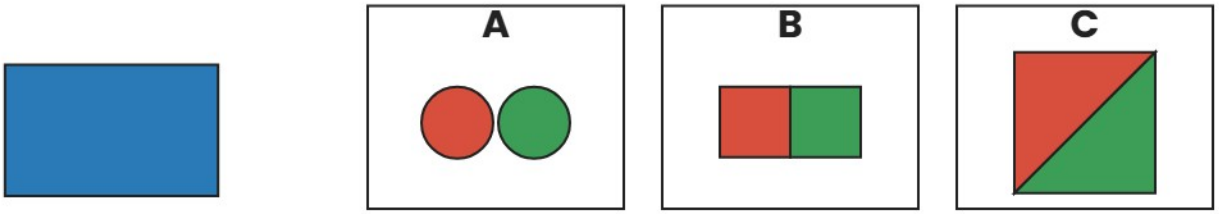

Math Practice - Kindergarten

M-K8 Shapes, 2D, 3D, positions, composing - Make a shape

M-K8 K.G.1, K.G.2, K.G.3, K.G.4, K.G.5, K.G.6

Name: _____ Date: _____

Which two shapes make the shape? Circle A, B, or C.

Example: Which two shapes make the triangle?

How: Put the two small shapes together in your head. The sides that touch disappear, and the outside edge is the new shape.

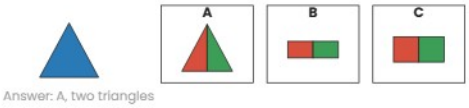

Answer: A, two triangles

1

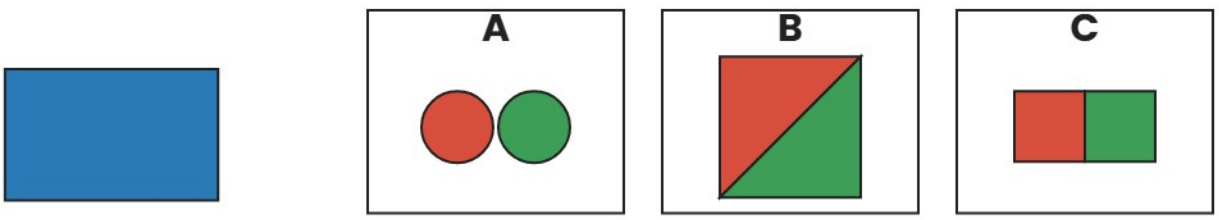

2

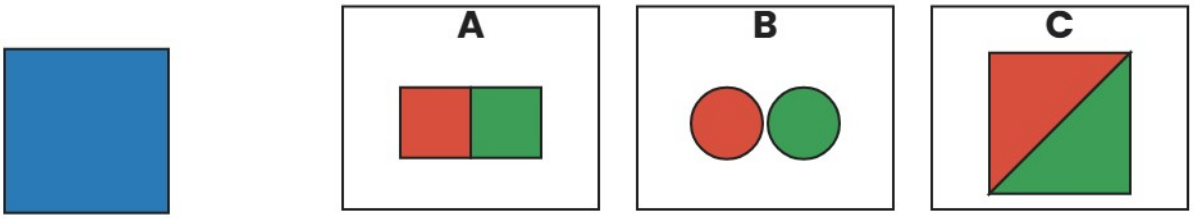

3

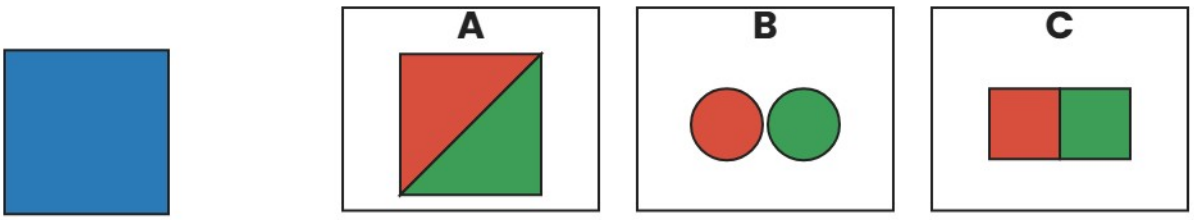

4

