Math Practice - Kindergarten

M-K7 Measurement and sorting - Longer or shorter

M-K7 K.MD.1, K.MD.2, K.MD.3

Name: _____ Date: _____

Circle the bar each question asks for.

Example: Circle the shorter bar.

How: Line the bars up at the left. The bar that goes further is the longer one, and the other is the shorter one.



Answer: Top

1 **Circle the shorter bar.**



2 **Circle the longer bar.**



3 **Circle the longer bar.**

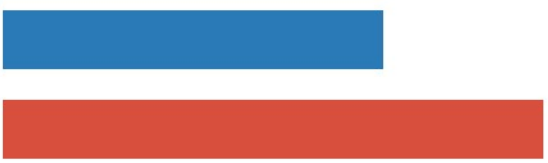

4 **Circle the longer bar.**



Math Practice - Kindergarten

M-K7 Measurement and sorting - Longer or shorter

M-K7 K.MD.1, K.MD.2, K.MD.3

Name: _____ Date: _____

Circle the bar each question asks for.

Example: Circle the shorter bar.

How: Line the bars up at the left. The bar that goes further is the longer one, and the other is the shorter one.

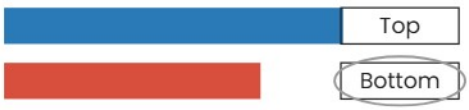

Answer: Bottom

---

1 **Circle the longer bar.**

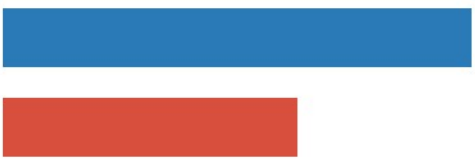

Top

Bottom

---

2 **Circle the longer bar.**



Top

Bottom

---

3 **Circle the shorter bar.**

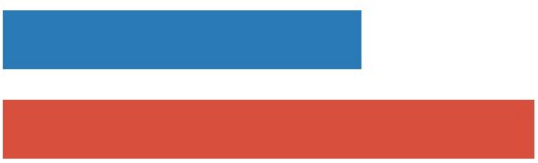

Top

Bottom

---

4 **Circle the longer bar.**



Top

Bottom

Math Practice - Kindergarten

M-K7 Measurement and sorting - Longer or shorter

M-K7 K.MD.1, K.MD.2, K.MD.3

Name: _____ Date: _____

Circle the bar each question asks for.

Example: Circle the longer bar.

How: Line the bars up at the left. The bar that goes further is the longer one, and the other is the shorter one.

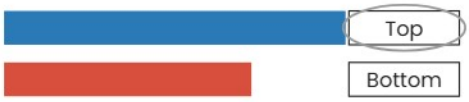

Answer: Top

---

1 **Circle the longer bar.**



Top

Bottom

---

2 **Circle the longer bar.**



Top

Bottom

---

3 **Circle the longer bar.**

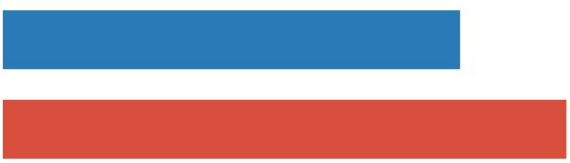

Top

Bottom

---

4 **Circle the longer bar.**



Top

Bottom