Math Practice - Kindergarten

M-K4 Addition within 10, putting together - Picture addition

M-K4 K.OA.1, K.OA.2, K.OA.5

Name: _____ Date: _____

Put together. How many in all?

Example: Put together. How many in all?

How: Count the first group, then keep counting the second group. That is how many in all.



1



2

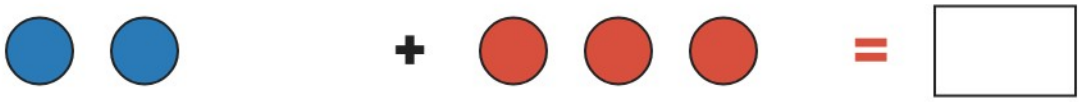

3

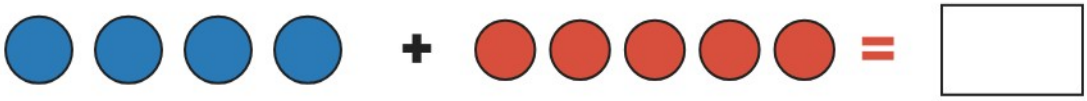

4

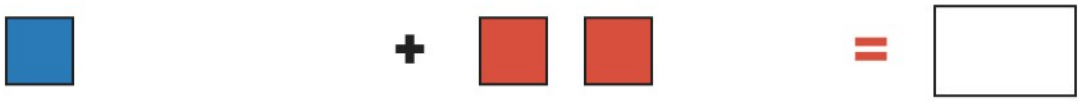

5



6



Math Practice - Kindergarten

M-K4 Addition within 10, putting together - Picture addition

M-K4 K.OA.1, K.OA.2, K.OA.5

Name: _____ Date: _____

Put together. How many in all?

Example: Put together. How many in all?

How: Count the first group, then keep counting the second group. That is how many in all.



1

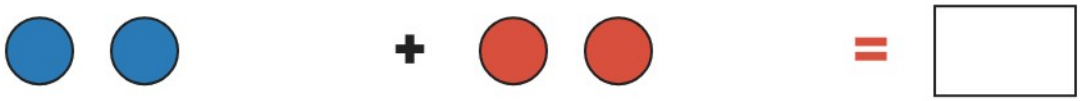

2



3



4



5



6

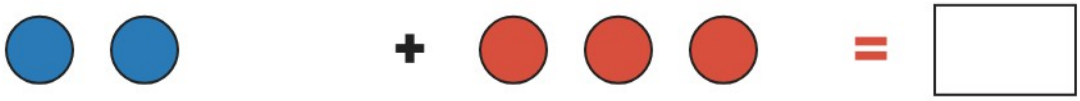

Math Practice - Kindergarten

M-K4 Addition within 10, putting together - Picture addition

M-K4 K.OA.1, K.OA.2, K.OA.5

Name: _____ Date: _____

Put together. How many in all?

Example: Put together. How many in all?

How: Count the first group, then keep counting the second group. That is how many in all.



1



2



3

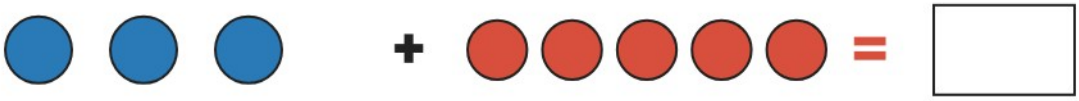

4



5

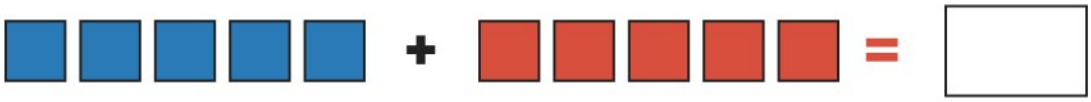

6

