Math Practice - Kindergarten

M-K3 Numbers 11 to 20 and counting to 100 - Ten frame teens

M-K3 K.CC.1, K.CC.3, K.NBT.1

Name: _____ Date: _____

Count all the dots. Write the number.

Example: Count all the dots. Write the number.

How: The frame holds 10 dots. Count the extra dots, then add them to 10.

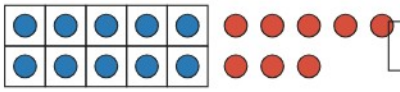

1

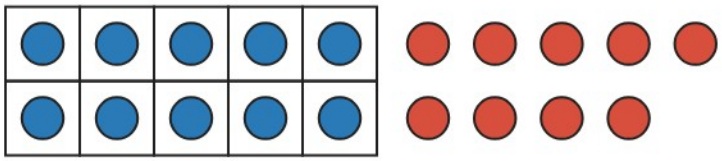

2

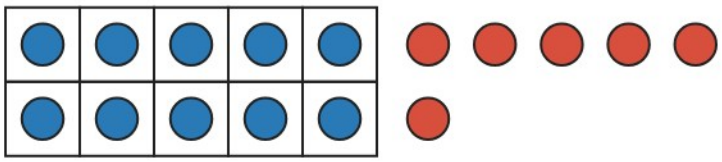

3

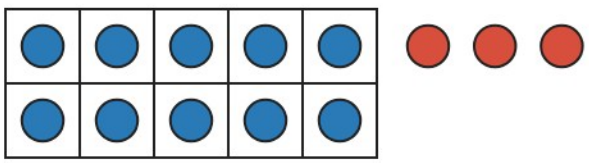

4

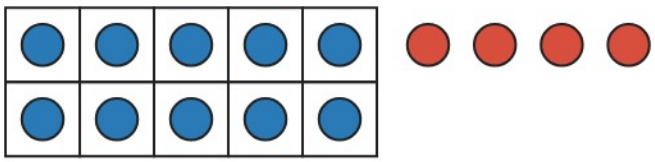

5

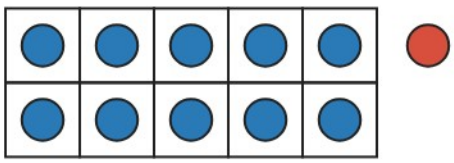

Math Practice - Kindergarten

M-K3 Numbers 11 to 20 and counting to 100 - Ten frame teens

M-K3 K.CC.1, K.CC.3, K.NBT.1

Name: _____ Date: _____

Count all the dots. Write the number.

Example: Count all the dots. Write the number.

How: The frame holds 10 dots. Count the extra dots, then add them to 10.

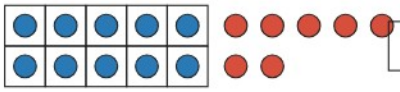

1

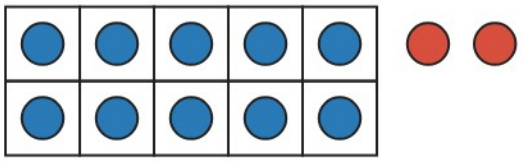

2

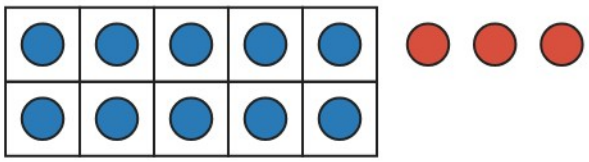

3

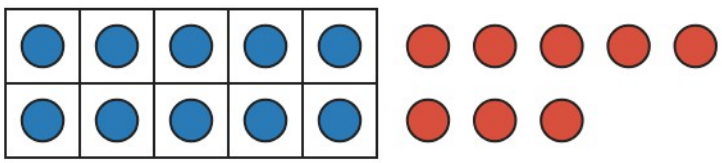

4

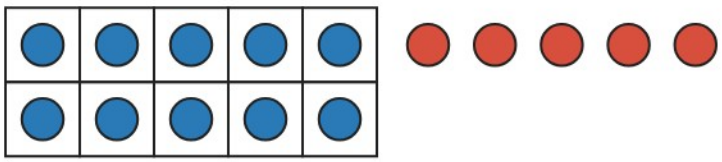

5

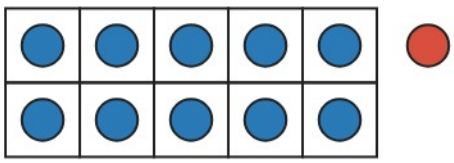

Math Practice - Kindergarten

M-K3 Numbers 11 to 20 and counting to 100 - Ten frame teens

M-K3 K.CC.1, K.CC.3, K.NBT.1

Name: _____ Date: _____

Count all the dots. Write the number.

Example: Count all the dots. Write the number.

How: The frame holds 10 dots. Count the extra dots, then add them to 10.

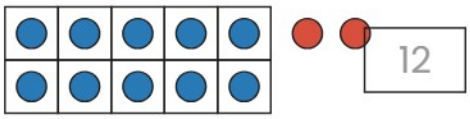

1

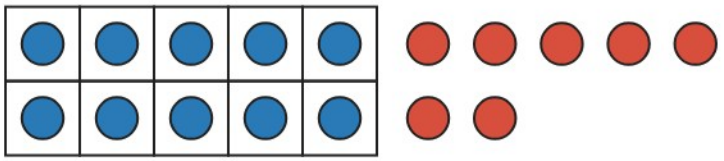

2

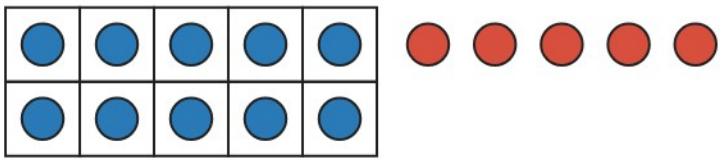

3

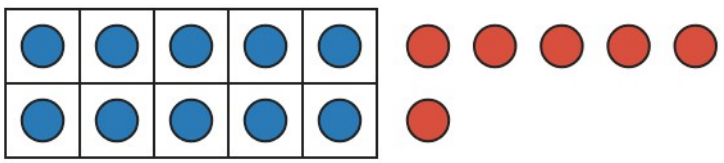

4

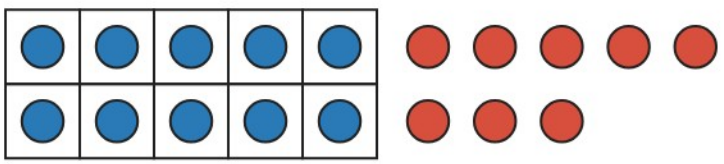

5

