Math Practice - Grade 8

M7 Systems of two linear equations - Find the point where two lines cross

M7 8.EE.C.8, 8.EE.C.8a, 8.EE.C.8b, 8.EE.C.8c

Name: _____ Date: _____

Read the graph. Write the solution as an ordered pair.

Example: Find the point where the two lines cross.

How: The solution is the point that sits on both lines at once. Read its x and y from the grid where the two lines meet.

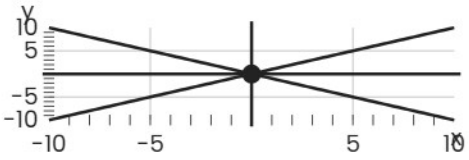

Solution (0, 0)

1

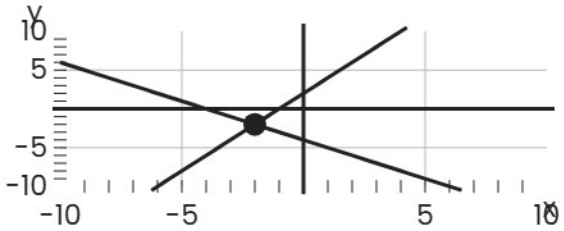

Solution

2

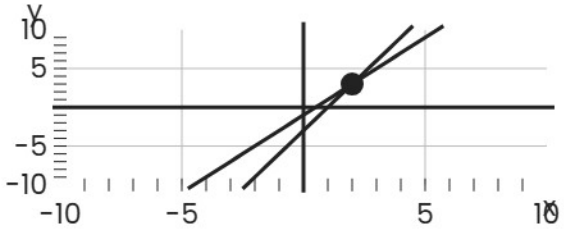

Solution

3

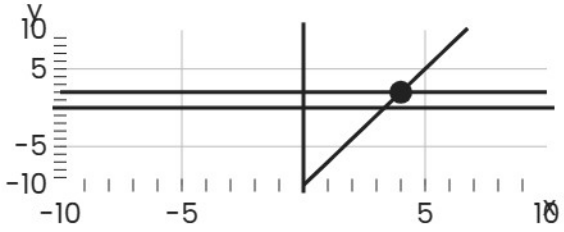

Solution

Math Practice - Grade 8

M7 Systems of two linear equations - Find the point where two lines cross

M7 8.EE.C.8, 8.EE.C.8a, 8.EE.C.8b, 8.EE.C.8c

Name: _____ Date: _____

Read the graph. Write the solution as an ordered pair.

Example: Find the point where the two lines cross.

How: The solution is the point that sits on both lines at once. Read its x and y from the grid where the two lines meet.

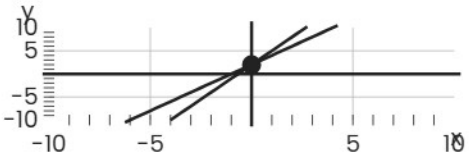

Solution (0, 2)

1

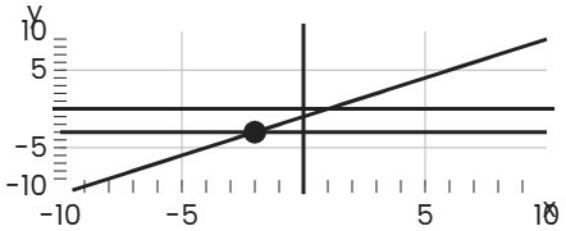

Solution

2

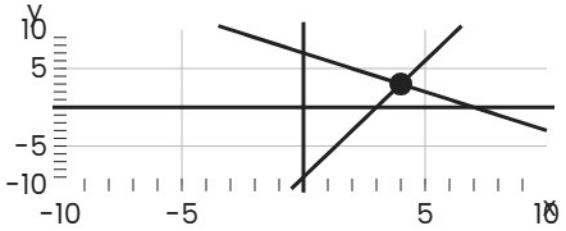

Solution

3

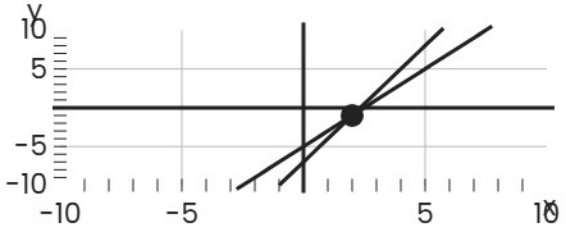

Solution

Math Practice - Grade 8

M7 Systems of two linear equations - Find the point where two lines cross

M7 8.EE.C.8, 8.EE.C.8a, 8.EE.C.8b, 8.EE.C.8c

Name: _____ Date: _____

Read the graph. Write the solution as an ordered pair.

Example: Find the point where the two lines cross.

How: The solution is the point that sits on both lines at once. Read its x and y from the grid where the two lines meet.

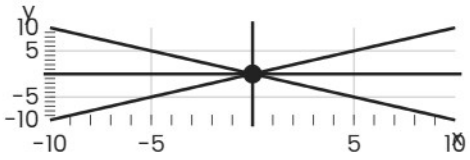

Solution (0, 0)

1

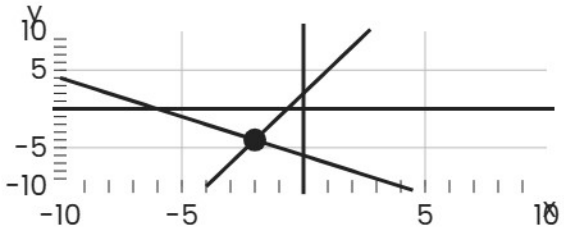

Solution

2

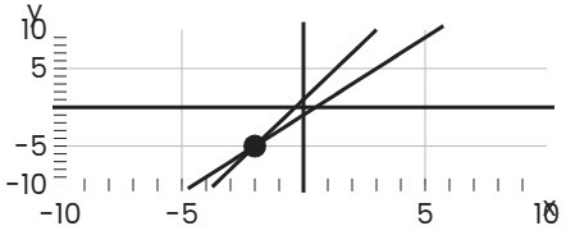

Solution

3

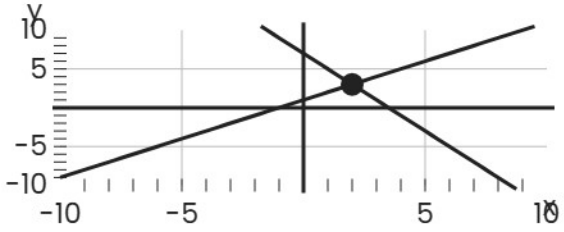

Solution