Math Practice - Grade 7

M8 Geometry: circles, angles, area and volume - Area and volume of composite figures

M8 7.G.4, 7.G.5, 7.G.6

Name: _____ Date: _____

Find the area or the volume. Write the answer in the box.

Example: Find the volume of the prism.

How: Break the figure into parts you know. Find each part on its own, then add them. Count every face of a solid, including the bottom.

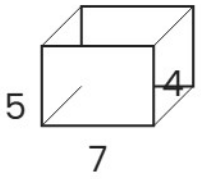

Volume 140

1

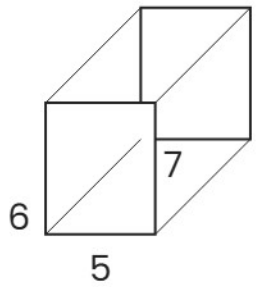

Volume ☐

2

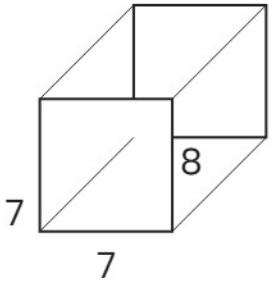

Surface area ☐

Math Practice - Grade 7

M8 Geometry: circles, angles, area and volume - Area and volume of composite figures

M8 7.G.4, 7.G.5, 7.G.6

Name: _____ Date: _____

Find the area or the volume. Write the answer in the box.

Example: Find the surface area of the prism.

How: Break the figure into parts you know. Find each part on its own, then add them. Count every face of a solid, including the bottom.

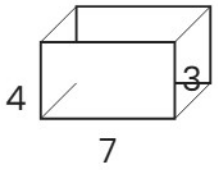

Surface area 122

1

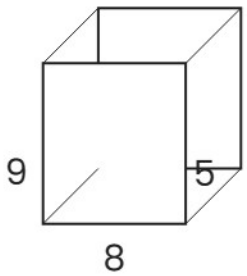

Surface area ☐

2

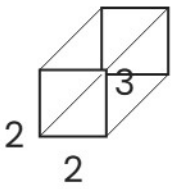

Volume ☐

Math Practice - Grade 7

M8 Geometry: circles, angles, area and volume - Area and volume of composite figures

M8 7.G.4, 7.G.5, 7.G.6

Name: _____ Date: _____

Find the area or the volume. Write the answer in the box.

Example: Find the surface area of the prism.

How: Break the figure into parts you know. Find each part on its own, then add them. Count every face of a solid, including the bottom.

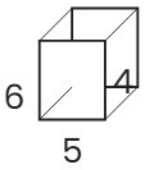

Surface area 148

1

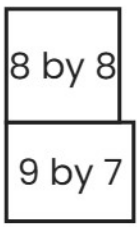

Area ☐

2

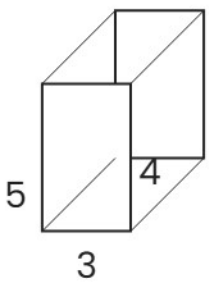

Volume ☐