Math Practice - Grade 7

M1 Add and subtract rational numbers - Show a sum on a number line

M1 7.NS.1, 7.NS.1a, 7.NS.1b, 7.NS.1c

Name: _____ Date: _____

Show the sum on the number line. Write the sum in the box.

Example: 6 + 2 = ?

How: Start at the first number. Move right for a positive addend and left for a negative addend. Where you land is the sum.

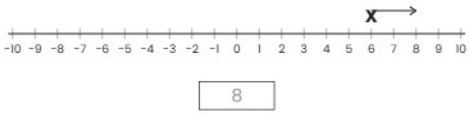

1 **7 + (-3) = ?**



2 **(-6) + 5 = ?**



3 **(-2) + 1 = ?**



Math Practice - Grade 7

M1 Add and subtract rational numbers - Show a sum on a number line

M1 7.NS.1, 7.NS.1a, 7.NS.1b, 7.NS.1c

Name: _____ Date: _____

Show the sum on the number line. Write the sum in the box.

Example: (-8) + 7 = ?

How: Start at the first number. Move right for a positive addend and left for a negative addend. Where you land is the sum.

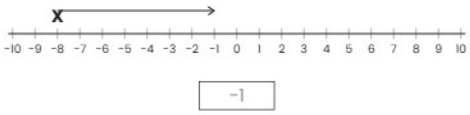

---

1 **(-6) + 6 = ?**



---

2 **9 + (-6) = ?**



---

3 **8 + 2 = ?**



Math Practice - Grade 7

M1 Add and subtract rational numbers - Show a sum on a number line

M1 7.NS.1, 7.NS.1a, 7.NS.1b, 7.NS.1c

Name: _____ Date: _____

Show the sum on the number line. Write the sum in the box.

Example: (-1) + 7 = ?

How: Start at the first number. Move right for a positive addend and left for a negative addend. Where you land is the sum.

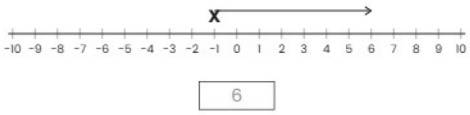

1 **3 + (-1) = ?**



2 **4 + (-2) = ?**

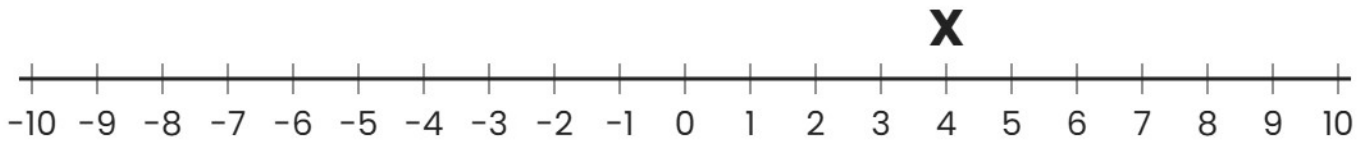

3 **(-3) + (-5) = ?**

