Math Practice - Grade 6

M12 Volume and surface area - Name the solid from its net

M12 6.G.A.2, 6.G.A.4

Name: _____ Date: _____

What solid does this net make? Circle it.

Example: What solid does this net make? Circle it.

How: Count the faces and look at their shapes. A cube has six square faces. A rectangular prism has six rectangle faces.

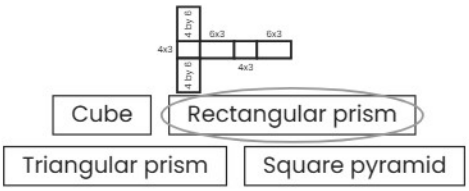

1

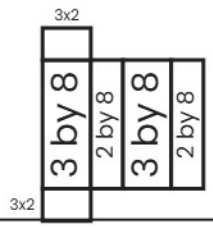

Cube | Rectangular prism | Triangular prism | Square pyramid

2

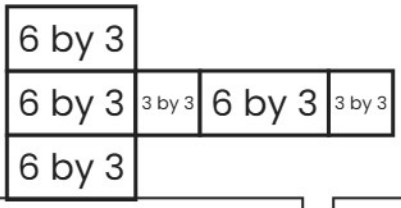

Cube | Rectangular prism | Triangular prism | Square pyramid

3



Cube | Rectangular prism | Triangular prism | Square pyramid

Math Practice - Grade 6

M12 Volume and surface area - Name the solid from its net

M12 6.G.A.2, 6.G.A.4

Name: _____ Date: _____

What solid does this net make? Circle it.

Example: What solid does this net make? Circle it.

How: Count the faces and look at their shapes. A cube has six square faces. A rectangular prism has six rectangle faces.

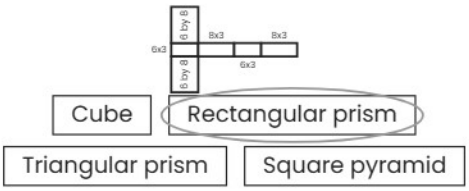

1

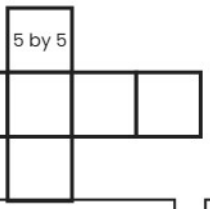

Cube | Rectangular prism | Triangular prism | ~~Square pyramid~~

2

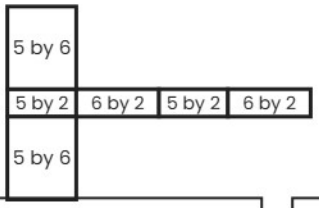

Cube | Rectangular prism | Triangular prism | ~~Square pyramid~~

3

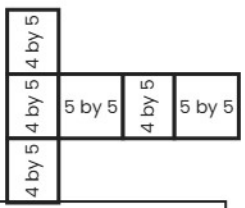

Cube | Rectangular prism | Triangular prism | Square pyramid

Math Practice - Grade 6

M12 Volume and surface area - Name the solid from its net

M12 6.G.A.2, 6.G.A.4

Name: _____ Date: _____

What solid does this net make? Circle it.

Example: What solid does this net make? Circle it.

How: Count the faces and look at their shapes. A cube has six square faces. A rectangular prism has six rectangle faces.

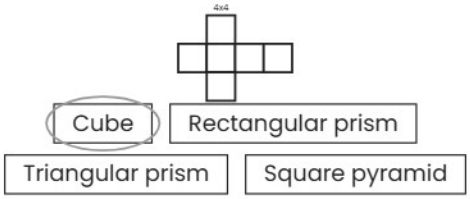

1

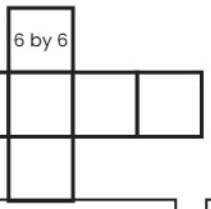

Cube | Rectangular prism | Triangular prism | Square pyramid

2

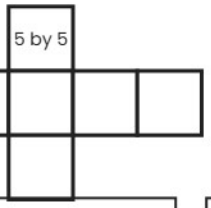

Cube | Rectangular prism | Triangular prism | Square pyramid

3

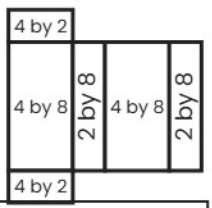

Cube | Rectangular prism | Triangular prism | Square pyramid