Math Practice - Grade 6

M11 Area of triangles and polygons - Area of a triangle

M11 6.G.A.1

Name: _____ Date: _____

Find the area of the triangle.

Example: Find the area of the triangle.

How: Area is one half times base times height. The height must be perpendicular to the base, not the slanted side.



base 15

142.5

1

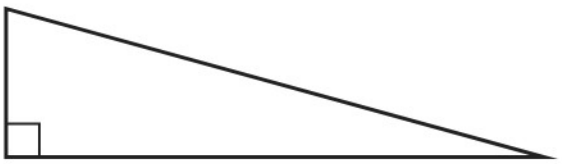

base 13

2

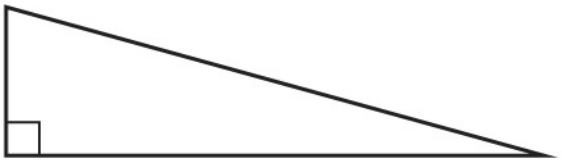

base 10

3

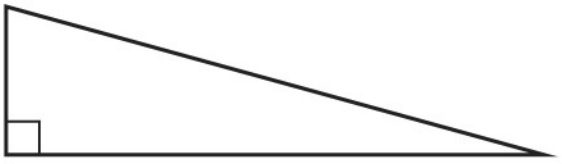

base 10

Math Practice - Grade 6

M11 Area of triangles and polygons - Area of a triangle

M11 6.G.A.1

Name: _____ Date: _____

Find the area of the triangle.

Example: Find the area of the triangle.

How: Area is one half times base times height. The height must be perpendicular to the base, not the slanted side.



base 12

72

1

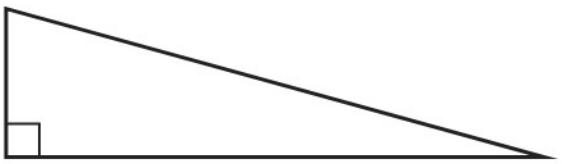

base 6

2

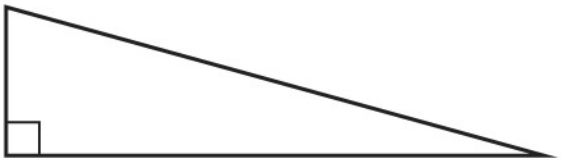

base 14

3

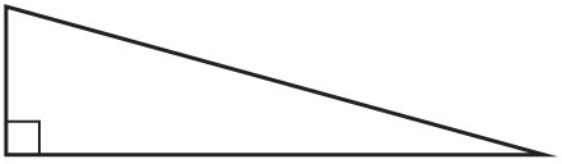

base 3

Math Practice - Grade 6

M11 Area of triangles and polygons - Area of a triangle

M11 6.G.A.1

Name: _____ Date: _____

Find the area of the triangle.

Example: Find the area of the triangle.

How: Area is one half times base times height. The height must be perpendicular to the base, not the slanted side.



base 4

26

1

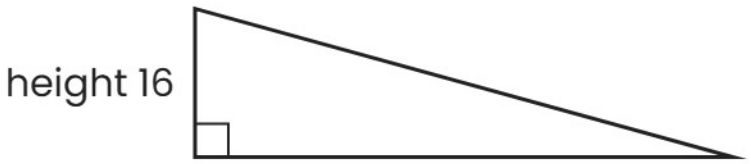

base 13

2

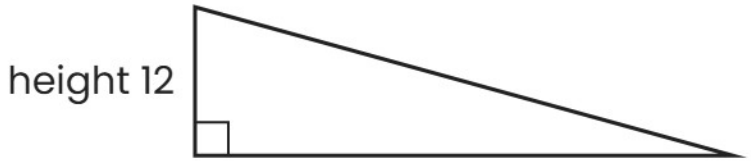

base 10

3



base 14