Math Practice - Grade 6

M11 Area of triangles and polygons - Area of a trapezoid

M11 6.G.A.1

Name: _____ Date: _____

Find the area of the trapezoid.

Example: Find the area of the trapezoid.

How: Add the two parallel sides, divide by 2, and multiply by the height. The height is the straight distance between the parallel sides.



114

1

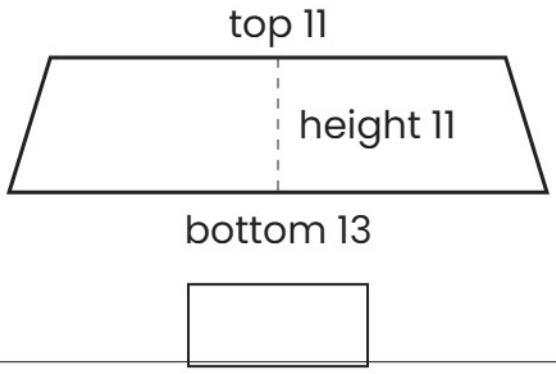

2

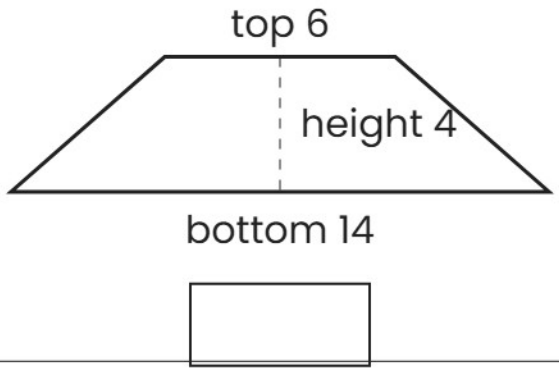

3

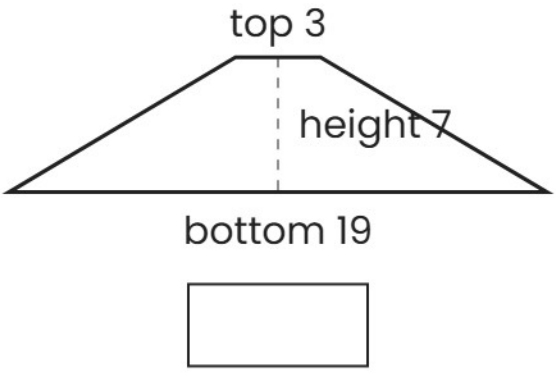

Math Practice - Grade 6

M11 Area of triangles and polygons - Area of a trapezoid

M11 6.G.A.1

Name: _____ Date: _____

Find the area of the trapezoid.

Example: Find the area of the trapezoid.

How: Add the two parallel sides, divide by 2, and multiply by the height. The height is the straight distance between the parallel sides.

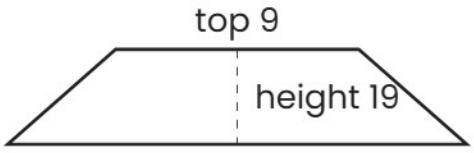

247

1

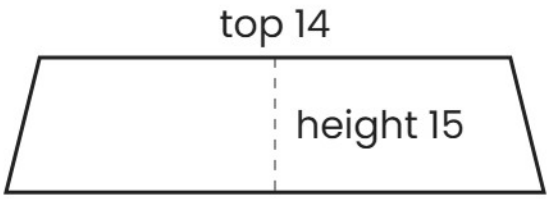

2

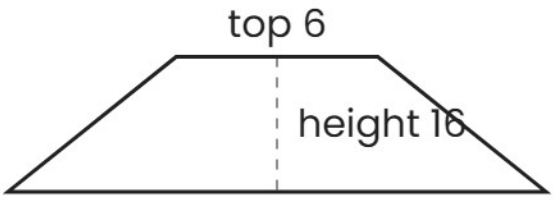

3

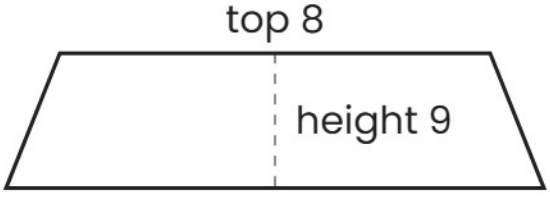

Math Practice - Grade 6

M11 Area of triangles and polygons - Area of a trapezoid

M11 6.G.A.1

Name: _____ Date: _____

Find the area of the trapezoid.

Example: Find the area of the trapezoid.

How: Add the two parallel sides, divide by 2, and multiply by the height. The height is the straight distance between the parallel sides.

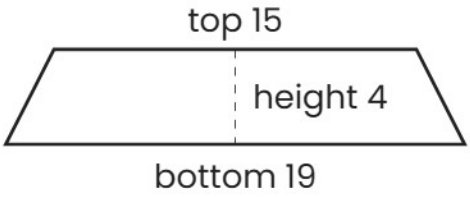

68

1

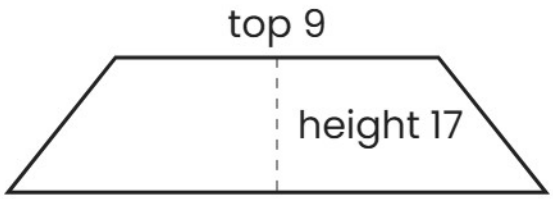

2

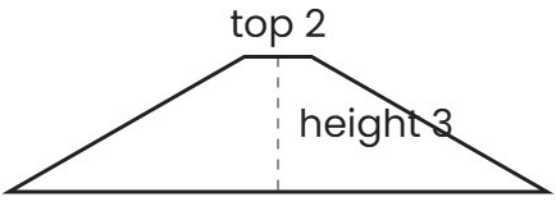

3

