Math Practice - Grade 6

M11 Area of triangles and polygons - Area of a parallelogram

M11 6.G.A.1

Name: _____ Date: _____

Find the area of the parallelogram.

Example: Find the area of the parallelogram.

How: Area is base times height. The height is the straight distance between the two bases, not the slanted side.



base 12

216

1



base 15

2



base 13

3



base 14

Math Practice - Grade 6

M11 Area of triangles and polygons - Area of a parallelogram

M11 6.G.A.1

Name: _____ Date: _____

Find the area of the parallelogram.

Example: Find the area of the parallelogram.

How: Area is base times height. The height is the straight distance between the two bases, not the slanted side.



base 3

42

1



base 10

2



base 16

3



base 20

Math Practice - Grade 6

M11 Area of triangles and polygons - Area of a parallelogram

M11 6.G.A.1

Name: _____ Date: _____

Find the area of the parallelogram.

Example: Find the area of the parallelogram.

How: Area is base times height. The height is the straight distance between the two bases, not the slanted side.



base 19

228

1



base 13

2



base 12

3



base 10