Math Practice - Grade 5

M9 Patterns and the coordinate plane - Read the coordinates of a point

M9 5.OA.B.3, 5.G.A.1, 5.G.A.2

Name: _____ Date: _____

What are the coordinates of the plotted point? Write them in the boxes.

Example: What are the coordinates of the plotted point? Write them in the boxes.

How: Count across from the origin first, for the x coordinate, then count up for the y coordinate. The pair is always (x, y).

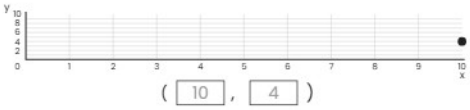

1

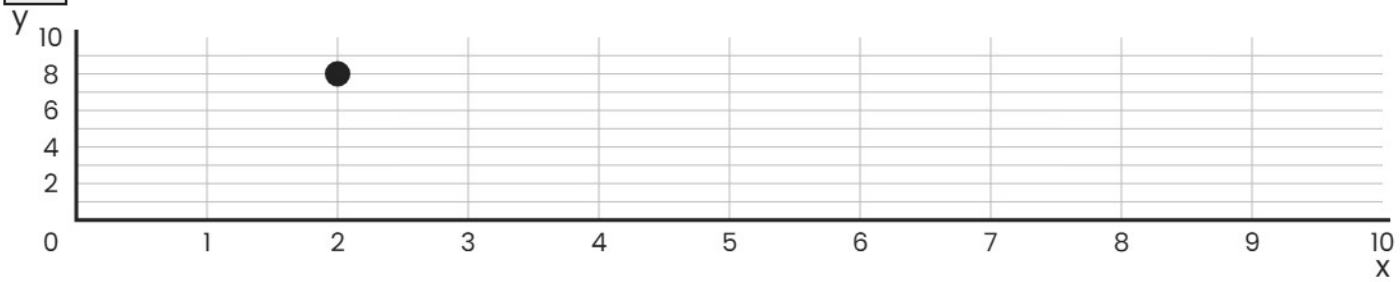

(☐ , ☐)

2

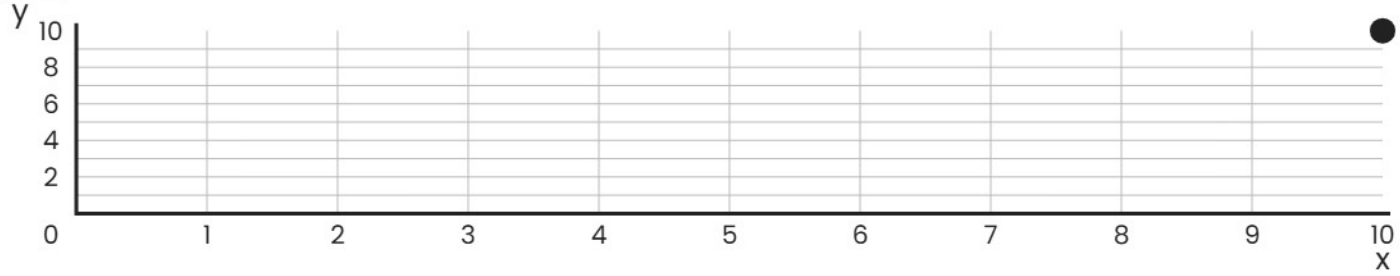

(☐ , ☐)

3

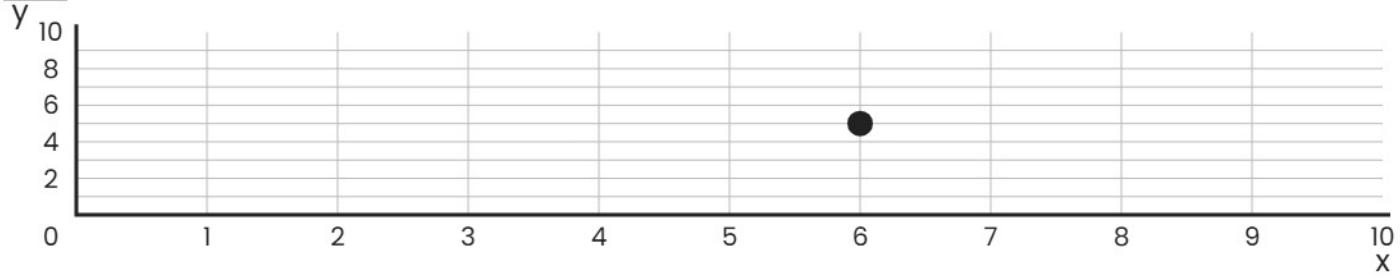

(☐ , ☐)

Math Practice - Grade 5

M9 Patterns and the coordinate plane - Read the coordinates of a point

M9 5.OA.B.3, 5.G.A.1, 5.G.A.2

Name: _____ Date: _____

What are the coordinates of the plotted point? Write them in the boxes.

Example: What are the coordinates of the plotted point? Write them in the boxes.

How: Count across from the origin first, for the x coordinate, then count up for the y coordinate. The pair is always (x, y).

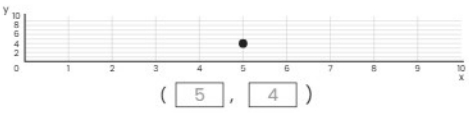

1

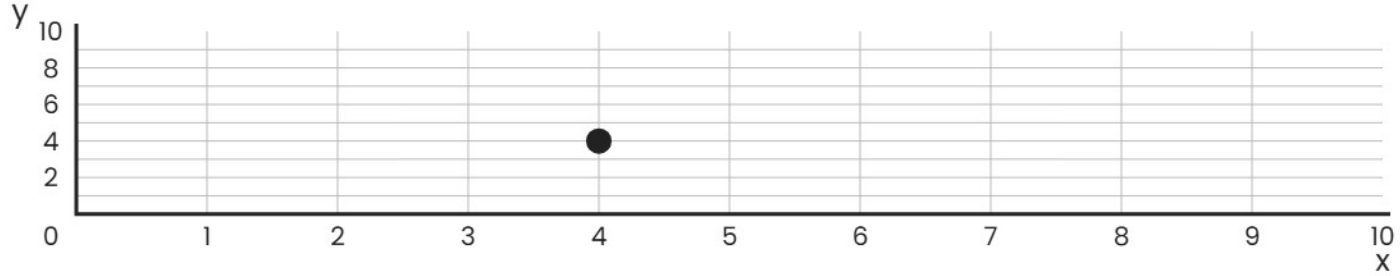

(☐ , ☐)

2

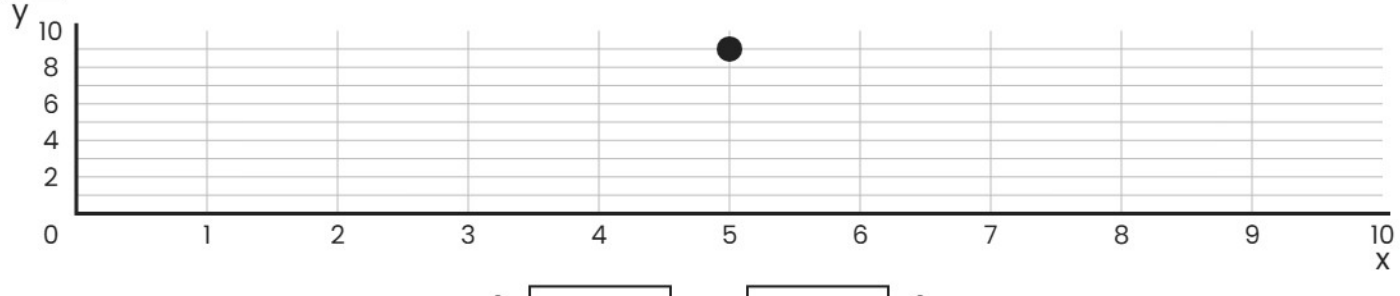

(☐ , ☐)

3

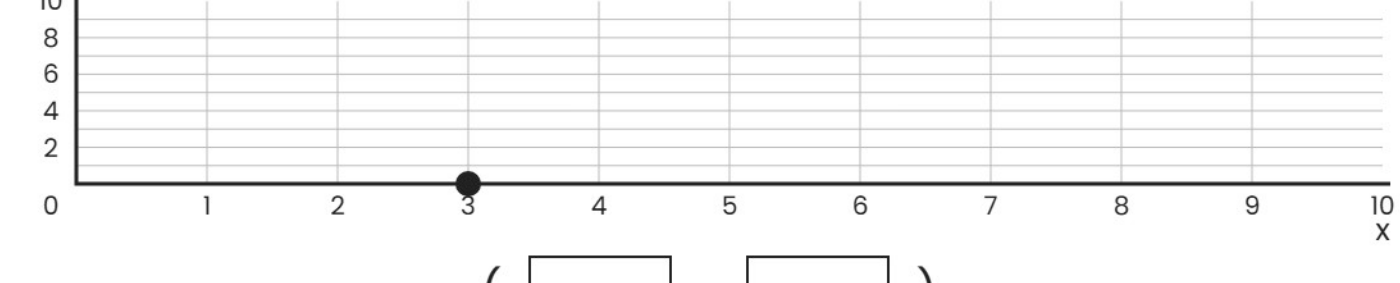

(☐ , ☐)

Math Practice - Grade 5

M9 Patterns and the coordinate plane - Read the coordinates of a point

M9 5.OA.B.3, 5.G.A.1, 5.G.A.2

Name: _____ Date: _____

What are the coordinates of the plotted point? Write them in the boxes.

Example: What are the coordinates of the plotted point? Write them in the boxes.

How: Count across from the origin first, for the x coordinate, then count up for the y coordinate. The pair is always (x, y).

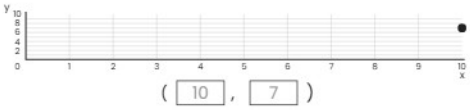

1

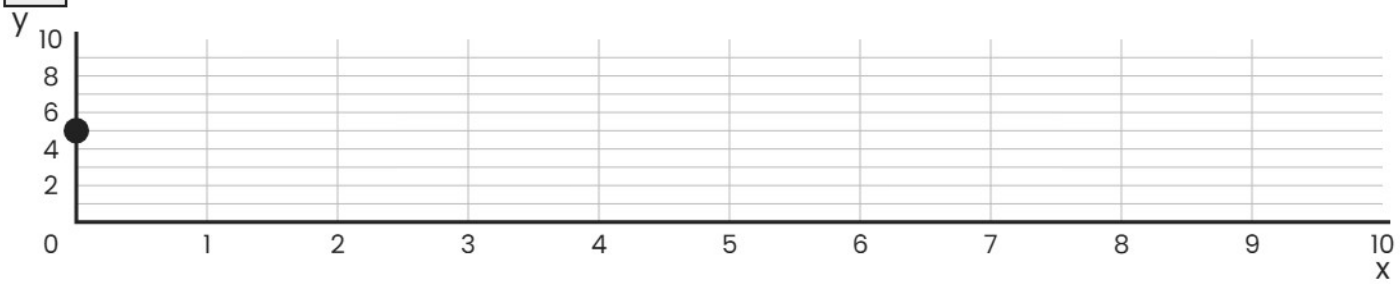

(☐ , ☐)

2

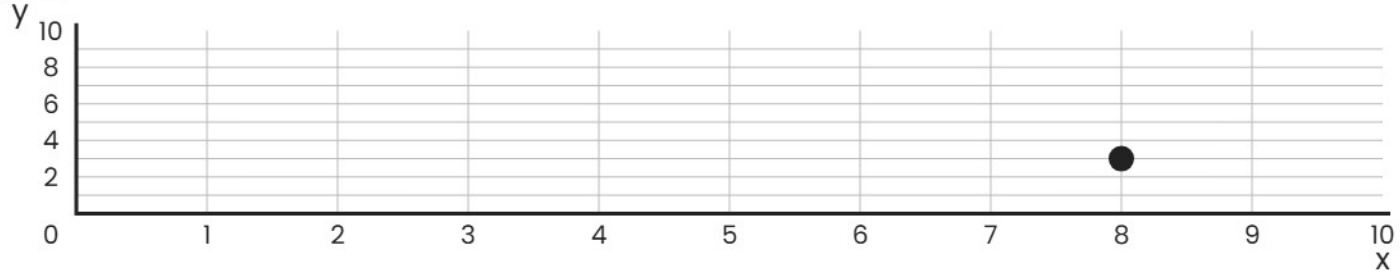

(☐ , ☐)

3

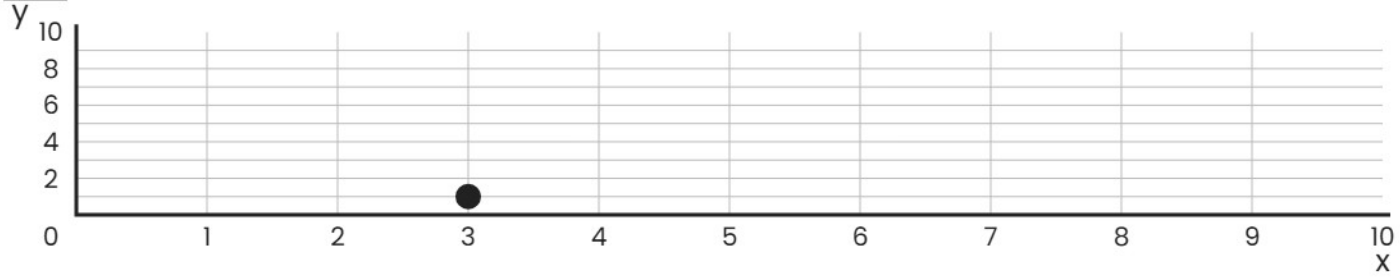

(☐ , ☐)