Math Practice - Grade 5

M12 Classify two dimensional figures - Sort figures into a hierarchy

M12 5.G.B.3, 5.G.B.4

Name: _____ Date: _____

List the categories this figure belongs to, from most specific to most general.

Example: List the categories this figure belongs to, from most specific to most general.

How: A figure in a smaller category has all the properties of every larger category above it. List every category the figure fits, from the smallest to the largest.



Categories: Parallelogram, Quadrilateral

1

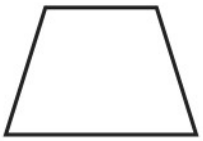

Categories: _____

2



Categories: _____

3



Categories: _____

Math Practice - Grade 5

M12 Classify two dimensional figures - Sort figures into a hierarchy

M12 5.G.B.3, 5.G.B.4

Name: _____ Date: _____

List the categories this figure belongs to, from most specific to most general.

Example: List the categories this figure belongs to, from most specific to most general.

How: A figure in a smaller category has all the properties of every larger category above it. List every category the figure fits, from the smallest to the largest.



Categories: Rhombus, Parallelogram, Quadrilateral

1



Categories: _____

2

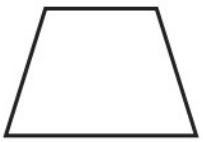

Categories: _____

3

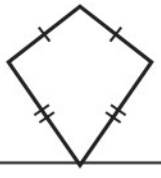

Categories: _____

Math Practice - Grade 5

M12 Classify two dimensional figures - Sort figures into a hierarchy

M12 5.G.B.3, 5.G.B.4

Name: _____ Date: _____

List the categories this figure belongs to, from most specific to most general.

Example: List the categories this figure belongs to, from most specific to most general.

How: A figure in a smaller category has all the properties of every larger category above it. List every category the figure fits, from the smallest to the largest.



Categories: Rhombus, Parallelogram, Quadrilateral

1

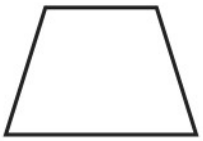

Categories:

2



Categories:

3

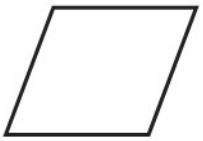

Categories: