# Math Practice - Grade 5

## M12 Classify two dimensional figures - Name the most specific category

M12 5.G.B.3, 5.G.B.4

Name: _____ Date: _____

What is the most specific name for this figure? Circle it.

**Example: What is the most specific name for this figure? Circle it.**

How: Use the properties, not how the figure looks. Match the side lengths, angles, and parallel sides to the name that fits them all.



4 equal sides, 4 right angles, 2 pairs of parallel sides

Rhombus | Rectangle | Kite | Square

---

**1**

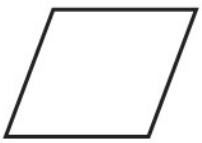

Opposite sides equal, no right angles, 2 pairs of parallel sides

Parallelogram | Square | Trapezoid | Rectangle

---

**2**



4 sides, no parallel sides, no right angles

Quadrilateral | Trapezoid | Square | Parallelogram

---

**3**

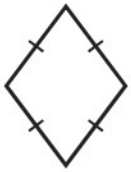

4 equal sides, no right angles, 2 pairs of parallel sides

Kite | Rhombus | Quadrilateral | Parallelogram

# Math Practice - Grade 5

## M12 Classify two dimensional figures - Name the most specific category

M12 5.G.B.3, 5.G.B.4

Name: _____ Date: _____

What is the most specific name for this figure? Circle it.

**Example: What is the most specific name for this figure? Circle it.**

How: Use the properties, not how the figure looks. Match the side lengths, angles, and parallel sides to the name that fits them all.

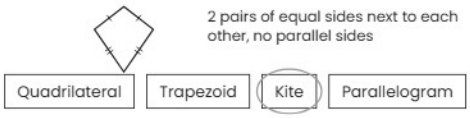


---

**1**



Opposite sides equal, no right angles, 2 pairs of parallel sides

Rectangle | Rhombus | Square | Parallelogram

---

**2**



4 sides, no parallel sides, no right angles

Quadrilateral | Rhombus | Rectangle | Trapezoid

---

**3**



4 equal sides, 4 right angles, 2 pairs of parallel sides

Quadrilateral | Square | Rhombus | Parallelogram

# Math Practice - Grade 5

## M12 Classify two dimensional figures - Name the most specific category

M12 5.G.B.3, 5.G.B.4

Name: _____ Date: _____

What is the most specific name for this figure? Circle it.

**Example: What is the most specific name for this figure? Circle it.**

How: Use the properties, not how the figure looks. Match the side lengths, angles, and parallel sides to the name that fits them all.

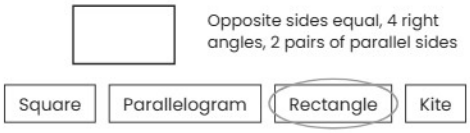


---

**1**



Opposite sides equal, no right angles, 2 pairs of parallel sides

Rectangle | Kite | Trapezoid | Parallelogram

---

**2**

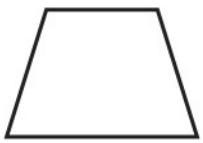

1 pair of parallel sides, no right angles

Trapezoid | Parallelogram | Kite | Rectangle

---

**3**



4 equal sides, 4 right angles, 2 pairs of parallel sides

Rectangle | Parallelogram | Trapezoid | Square