Math Practice - Grade 4

M9 Multiply a fraction by a whole number - Repeated fraction bars

M9 4.NF.B.4, 4.NF.B.4a, 4.NF.B.4b, 4.NF.B.4c

Name: _____ Date: _____

Count the shaded unit fractions in all the bars. Write the total.

Example: Count the shaded unit fractions in all the bars. Write the total.

How: Each bar shows the same fraction. Count the shaded parts in all the bars together, then write the total as a fraction or a mixed number.

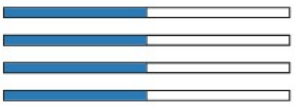

Total: 2

1



Total: ☐

2



Total: ☐ ☐/☐

3

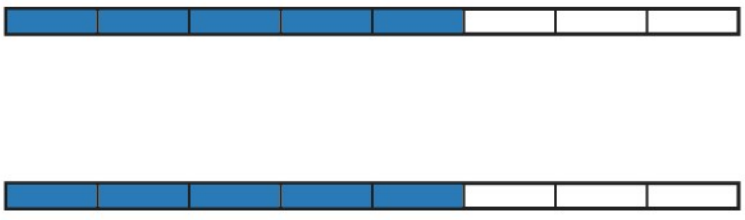

Total: ☐ ☐/☐

Math Practice - Grade 4

M9 Multiply a fraction by a whole number - Repeated fraction bars

M9 4.NF.B.4, 4.NF.B.4a, 4.NF.B.4b, 4.NF.B.4c

Name: _____ Date: _____

Count the shaded unit fractions in all the bars. Write the total.

Example: Count the shaded unit fractions in all the bars. Write the total.

How: Each bar shows the same fraction. Count the shaded parts in all the bars together, then write the total as a fraction or a mixed number.



Total: 3

1



Total: ☐ ☐/☐

2

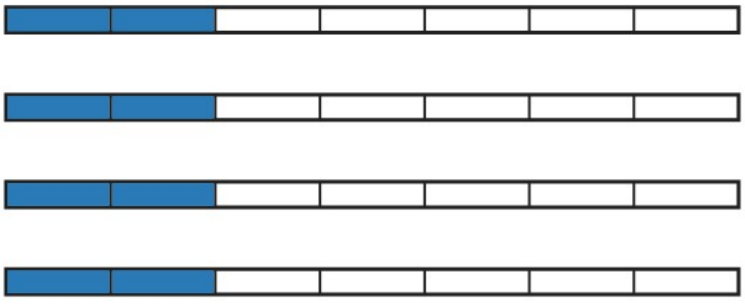

Total: ☐ ☐/☐

3



Total: ☐ ☐/☐

Math Practice - Grade 4

M9 Multiply a fraction by a whole number - Repeated fraction bars

M9 4.NF.B.4, 4.NF.B.4a, 4.NF.B.4b, 4.NF.B.4c

Name: _____ Date: _____

Count the shaded unit fractions in all the bars. Write the total.

Example: Count the shaded unit fractions in all the bars. Write the total.

How: Each bar shows the same fraction. Count the shaded parts in all the bars together, then write the total as a fraction or a mixed number.



Total: $\frac{3}{8}$

1

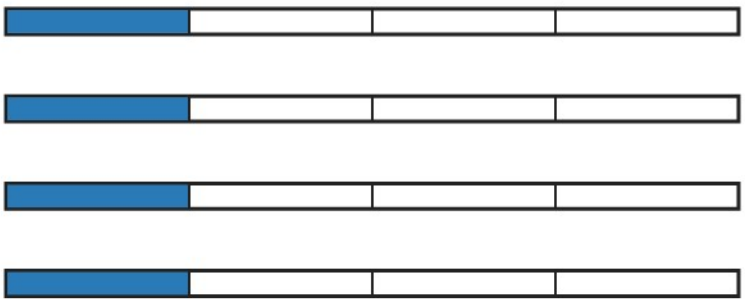

Total: ☐

2



Total: ☐ $\frac{\square}{\square}$

3

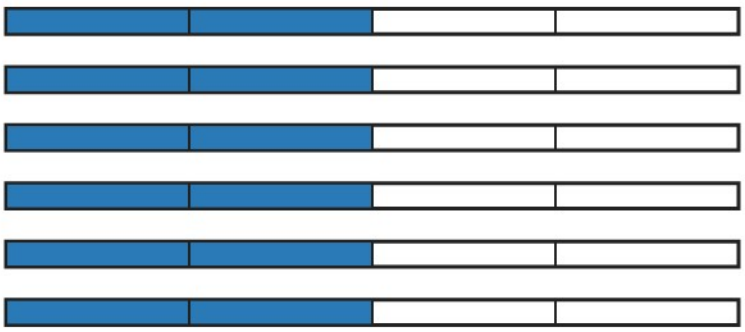

Total: ☐