Math Practice - Grade 4

M13 Angles and geometry - Measure an angle

M13 4.MD.C.5, 4.MD.C.5a, 4.MD.C.5b, 4.MD.C.6, 4.MD.C.7, 4.G.A.1, 4.G.A.2, 4.G.A.3

Name: _____ Date: _____

How many degrees is the angle? Write the answer in the box.

Example: How many degrees is the angle?

How: The opening of the angle is what you measure, not how long the rays are. A wider opening means more degrees.



Angle = 130 degrees

1

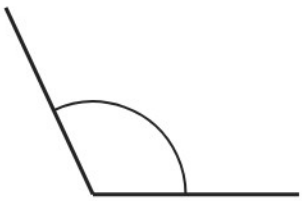

Angle = _____ degrees

2



Angle = _____ degrees

3

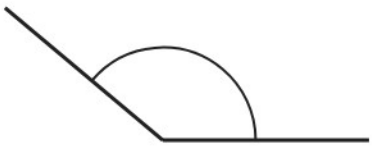

Angle = _____ degrees

Math Practice - Grade 4

M13 Angles and geometry - Measure an angle

M13 4.MD.C.5, 4.MD.C.5a, 4.MD.C.5b, 4.MD.C.6, 4.MD.C.7, 4.G.A.1, 4.G.A.2, 4.G.A.3

Name: _____ Date: _____

How many degrees is the angle? Write the answer in the box.

Example: How many degrees is the angle?

How: The opening of the angle is what you measure, not how long the rays are. A wider opening means more degrees.



Angle = 155 degrees

1

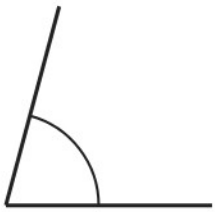

Angle = _____ degrees

2

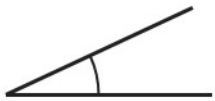

Angle = _____ degrees

3

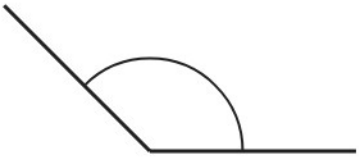

Angle = _____ degrees

Math Practice - Grade 4

M13 Angles and geometry - Measure an angle

M13 4.MD.C.5, 4.MD.C.5a, 4.MD.C.5b, 4.MD.C.6, 4.MD.C.7, 4.G.A.1, 4.G.A.2, 4.G.A.3

Name: _____ Date: _____

How many degrees is the angle? Write the answer in the box.

Example: How many degrees is the angle?

How: The opening of the angle is what you measure, not how long the rays are. A wider opening means more degrees.



Angle = 85 degrees

1



Angle = _____ degrees

2



Angle = _____ degrees

3

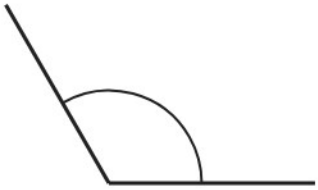

Angle = _____ degrees