Math Practice - Grade 4

M13 Angles and geometry - Lines of symmetry

M13 4.MD.C.5, 4.MD.C.5a, 4.MD.C.5b, 4.MD.C.6, 4.MD.C.7, 4.G.A.1, 4.G.A.2, 4.G.A.3

Name: _____ Date: _____

Draw the line of symmetry for the shape.

Example: Draw the line of symmetry of the square.

How: Fold the shape along the line and the two halves must match exactly. If they do not match, it is not a line of symmetry.

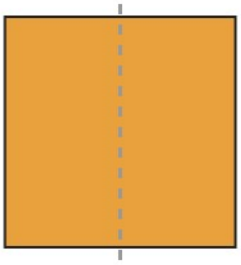

---

1 **Draw the line of symmetry of the rectangle.**



---

2 **Draw the line of symmetry of the rhombus.**



---

3 **Draw the line of symmetry of the circle.**



Math Practice - Grade 4

M13 Angles and geometry - Lines of symmetry

M13 4.MD.C.5, 4.MD.C.5a, 4.MD.C.5b, 4.MD.C.6, 4.MD.C.7, 4.G.A.1, 4.G.A.2, 4.G.A.3

Name: _____ Date: _____

Draw the line of symmetry for the shape.

Example: Draw the line of symmetry of the rhombus.

How: Fold the shape along the line and the two halves must match exactly. If they do not match, it is not a line of symmetry.



1 **Draw the line of symmetry of the triangle.**

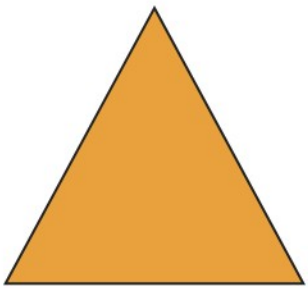

2 **Draw the line of symmetry of the circle.**



3 **Draw the line of symmetry of the square.**



Math Practice - Grade 4

M13 Angles and geometry - Lines of symmetry

M13 4.MD.C.5, 4.MD.C.5a, 4.MD.C.5b, 4.MD.C.6, 4.MD.C.7, 4.G.A.1, 4.G.A.2, 4.G.A.3

Name: _____ Date: _____

Draw the line of symmetry for the shape.

Example: Draw the line of symmetry of the square.

How: Fold the shape along the line and the two halves must match exactly. If they do not match, it is not a line of symmetry.

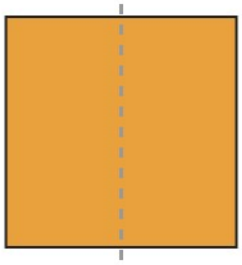

---

1 **Draw the line of symmetry of the rhombus.**



---

2 **Draw the line of symmetry of the circle.**



---

3 **Draw the line of symmetry of the triangle.**

