Math Practice - Grade 4

M13 Angles and geometry - Classify shapes

M13 4.MD.C.5, 4.MD.C.5a, 4.MD.C.5b, 4.MD.C.6, 4.MD.C.7, 4.G.A.1, 4.G.A.2, 4.G.A.3

Name: _____ Date: _____

How many right angles does the shape have? Does it have parallel sides?

Example: Does the shape have parallel sides?

How: A right angle is a square corner. Parallel sides run in the same direction and never meet.



Trapezoid

(Yes) No

1



Trapezoid

Right angles = ☐

2



Rhombus

Yes No

3

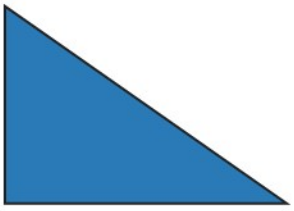

Right triangle

Yes No

Math Practice - Grade 4

M13 Angles and geometry - Classify shapes

M13 4.MD.C.5, 4.MD.C.5a, 4.MD.C.5b, 4.MD.C.6, 4.MD.C.7, 4.G.A.1, 4.G.A.2, 4.G.A.3

Name: _____ Date: _____

How many right angles does the shape have? Does it have parallel sides?

Example: Does the shape have parallel sides?

How: A right angle is a square corner. Parallel sides run in the same direction and never meet.



Rhombus

Yes

No

1

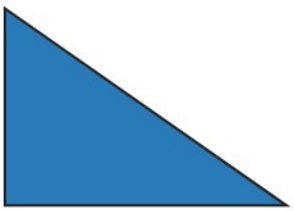

Right triangle

Yes No

2



Rectangle

Right angles = ____

3



Rectangle

Yes No

Math Practice - Grade 4

M13 Angles and geometry - Classify shapes

M13 4.MD.C.5, 4.MD.C.5a, 4.MD.C.5b, 4.MD.C.6, 4.MD.C.7, 4.G.A.1, 4.G.A.2, 4.G.A.3

Name: _____ Date: _____

How many right angles does the shape have? Does it have parallel sides?

Example: Does the shape have parallel sides?

How: A right angle is a square corner. Parallel sides run in the same direction and never meet.



Rhombus

(Yes) No

1



Rhombus

Right angles = ☐

2



Rectangle

Right angles = ☐

3



Rectangle

Yes No