Math Practice - Grade 3

M4 Division as sharing and grouping - Share equally

M4 3.OA.A.2, 3.OA.A.4, 3.OA.B.6

Name: _____ Date: _____

Share the objects equally. How many on each plate? Write the division.

Example: Jack shares 4 balloons equally among 2 plates. How many balloons are on each plate?

How: Share one object at a time round the plates until none are left. Each plate ends up with the same number.

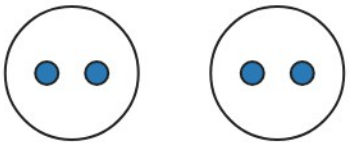

4 / 2 = 2

---

1 **Owen shares 10 buttons equally among 5 plates. How many buttons are on each plate?**



10 / 5 = ☐

---

2 **Jack shares 18 apples equally among 3 plates. How many apples are on each plate?**



18 / 3 = ☐

---

3 **Noah shares 20 seashells equally among 2 plates. How many seashells are on each plate?**



20 / 2 = ☐

Math Practice - Grade 3

M4 Division as sharing and grouping - Share equally

M4 3.OA.A.2, 3.OA.A.4, 3.OA.B.6

Name: _____ Date: _____

Share the objects equally. How many on each plate? Write the division.

Example: Ella shares 27 pencils equally among 9 plates. How many pencils are on each plate?

How: Share one object at a time round the plates until none are left. Each plate ends up with the same number.

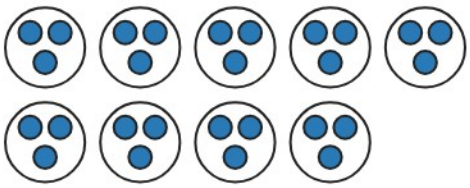

27 / 9 = 3

---

1 **Owen shares 28 toy cars equally among 4 plates. How many toy cars are on each plate?**



28 / 4 = ☐

---

2 **Lily shares 70 pencils equally among 7 plates. How many pencils are on each plate?**



70 / 7 = ☐

---

3 **Ava shares 36 crayons equally among 6 plates. How many crayons are on each plate?**



36 / 6 = ☐

Math Practice - Grade 3

M4 Division as sharing and grouping - Share equally

M4 3.OA.A.2, 3.OA.A.4, 3.OA.B.6

Name: _____ Date: _____

Share the objects equally. How many on each plate? Write the division.

Example: Zoe shares 81 cookies equally among 9 plates. How many cookies are on each plate?

How: Share one object at a time round the plates until none are left. Each plate ends up with the same number.

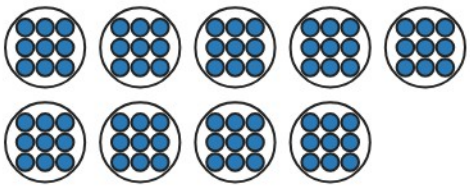

81 / 9 = 9

---

1 **Max shares 90 books equally among 10 plates. How many books are on each plate?**

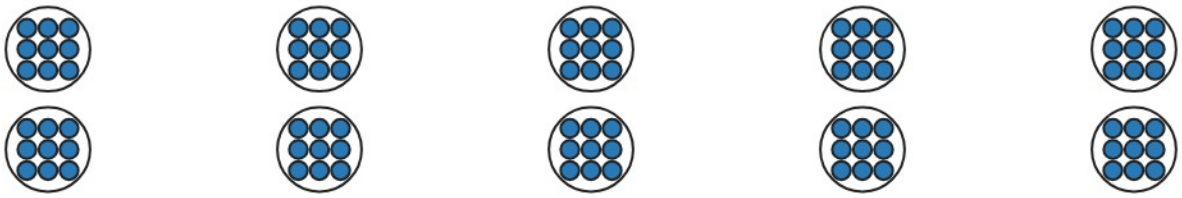

90 / 10 = ☐

---

2 **Zoe shares 16 pencils equally among 8 plates. How many pencils are on each plate?**

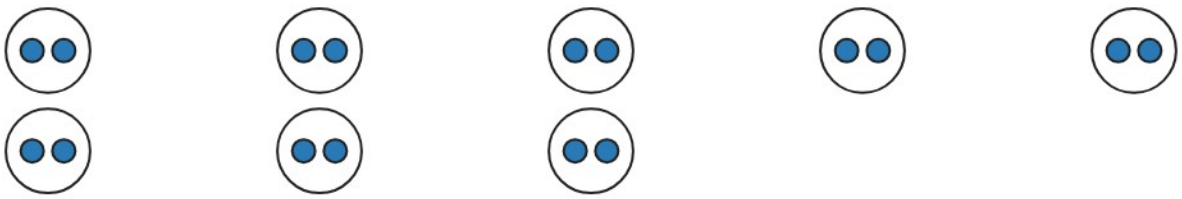

16 / 8 = ☐

---

3 **Zoe shares 12 books equally among 2 plates. How many books are on each plate?**



12 / 2 = ☐