Math Practice - Grade 3

M3 Multiplication as equal groups and arrays - Equal groups

M3 3.OA.A.1, 3.OA.A.3

Name: _____ Date: _____

How many groups? How many in each group? Write the multiplication.

Example: How many groups? How many in each group? Write the multiplication.

How: Count the groups first, then count how many are in one group. Groups times group size is the total.



8 x 9 = 72

1



5 x 5 = ☐

2



9 x 9 = ☐

3



8 x 3 = ☐

Math Practice - Grade 3

M3 Multiplication as equal groups and arrays - Equal groups

M3 3.OA.A.1, 3.OA.A.3

Name: _____ Date: _____

How many groups? How many in each group? Write the multiplication.

Example: How many groups? How many in each group? Write the multiplication.

How: Count the groups first, then count how many are in one group. Groups times group size is the total.



4 x 8 = 32

1

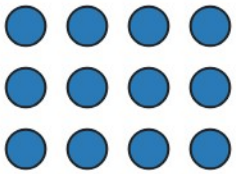

3 x 4 = ☐

2



5 x 3 = ☐

3



5 x 7 = ☐

Math Practice - Grade 3

M3 Multiplication as equal groups and arrays - Equal groups

M3 3.OA.A.1, 3.OA.A.3

Name: _____ Date: _____

How many groups? How many in each group? Write the multiplication.

Example: How many groups? How many in each group? Write the multiplication.

How: Count the groups first, then count how many are in one group. Groups times group size is the total.



9 x 3 = 27

1



8 x 4 = ☐

2



9 x 2 = ☐

3



8 x 8 = ☐