Math Practice - Grade 3

M3 Multiplication as equal groups and arrays - Arrays

M3 3.OA.A.1, 3.OA.A.3

Name: _____ Date: _____

How many rows? How many columns? Write the multiplication.

Example: How many rows? How many columns? Write the multiplication.

How: Count the rows first, then count how many dots are in one row. Rows times columns is the total.



10 x 2 = 20

1



5 x 7 = ☐

2



4 x 10 = ☐

3



8 x 2 = ☐

Math Practice - Grade 3

M3 Multiplication as equal groups and arrays - Arrays

M3 3.OA.A.1, 3.OA.A.3

Name: _____ Date: _____

How many rows? How many columns? Write the multiplication.

Example: How many rows? How many columns? Write the multiplication.

How: Count the rows first, then count how many dots are in one row. Rows times columns is the total.



8 x 8 = 64

1



2 x 10 = ☐

2



2 x 5 = ☐

3



6 x 8 = ☐

Math Practice - Grade 3

M3 Multiplication as equal groups and arrays - Arrays

M3 3.OA.A.1, 3.OA.A.3

Name: _____ Date: _____

How many rows? How many columns? Write the multiplication.

Example: How many rows? How many columns? Write the multiplication.

How: Count the rows first, then count how many dots are in one row. Rows times columns is the total.



7 x 5 = 35

1



5 x 3 = ☐

2



10 x 4 = ☐

3



9 x 3 = ☐