Math Practice - Grade 3

M13 Shapes and equal shares - Sort shapes by sides and angles

M13 3.G.A.1, 3.G.A.2

Name: _____ Date: _____

How many sides? How many angles? Is it a quadrilateral?

Example: Is this shape a quadrilateral? Circle Yes or No.

How: Count the straight sides. Corners are where two sides meet. Four sides means it is a quadrilateral.



Yes No

1

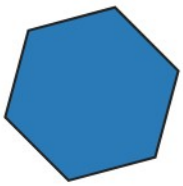

Yes No

2



Yes No

3



Yes No

Math Practice - Grade 3

M13 Shapes and equal shares - Sort shapes by sides and angles

M13 3.G.A.1, 3.G.A.2

Name: _____ Date: _____

How many sides? How many angles? Is it a quadrilateral?

Example: Is this shape a quadrilateral? Circle Yes or No.

How: Count the straight sides. Corners are where two sides meet. Four sides means it is a quadrilateral.



Yes No

1



Yes No

2



Yes No

3



Yes No

Math Practice - Grade 3

M13 Shapes and equal shares - Sort shapes by sides and angles

M13 3.G.A.1, 3.G.A.2

Name: _____ Date: _____

How many sides? How many angles? Is it a quadrilateral?

Example: Is this shape a quadrilateral? Circle Yes or No.

How: Count the straight sides. Corners are where two sides meet. Four sides means it is a quadrilateral.



Yes No

1

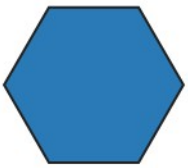

Yes No

2



Yes No

3



Yes No