Math Practice - Grade 3

M13 Shapes and equal shares - Partition into equal shares

M13 3.G.A.1, 3.G.A.2

Name: _____ Date: _____

Each part is what fraction of the whole?

Example: Each part is what fraction of the whole?

How: Count the equal parts. One part out of that many is a unit fraction: one part is one over the number of parts.

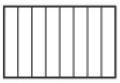

One part is $\frac{1}{8}$

---

1 **Each part is what fraction of the whole?**



One part is $\frac{\square}{\square}$

---

2 **Each part is what fraction of the whole?**



One part is $\frac{\square}{\square}$

---

3 **Each part is what fraction of the whole?**



One part is $\frac{\square}{\square}$

Math Practice - Grade 3

M13 Shapes and equal shares - Partition into equal shares

M13 3.G.A.1, 3.G.A.2

Name: _____ Date: _____

Each part is what fraction of the whole?

Example: Each part is what fraction of the whole?

How: Count the equal parts. One part out of that many is a unit fraction: one part is one over the number of parts.

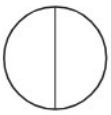

One part is $\frac{1}{2}$

---

1 **Each part is what fraction of the whole?**



One part is $\frac{\quad}{\quad}$

---

2 **Each part is what fraction of the whole?**



One part is $\frac{\quad}{\quad}$

---

3 **Each part is what fraction of the whole?**

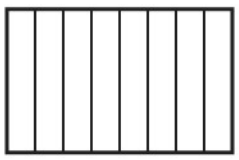

One part is $\frac{\quad}{\quad}$

Math Practice - Grade 3

M13 Shapes and equal shares - Partition into equal shares

M13 3.G.A.1, 3.G.A.2

Name: _____ Date: _____

Each part is what fraction of the whole?

Example: Each part is what fraction of the whole?

How: Count the equal parts. One part out of that many is a unit fraction: one part is one over the number of parts.



One part is $\frac{1}{2}$

---

1 **Each part is what fraction of the whole?**



One part is $\frac{\quad}{\quad}$

---

2 **Each part is what fraction of the whole?**



One part is $\frac{\quad}{\quad}$

---

3 **Each part is what fraction of the whole?**

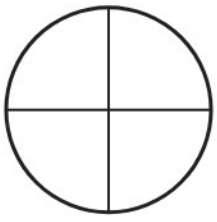

One part is $\frac{\quad}{\quad}$