Math Practice - Grade 3

M12 Perimeter, and area versus perimeter - Find the perimeter

M12 3.MD.D.8

Name: _____ Date: _____

Add all the side lengths to find the perimeter.

Example: Add the side lengths to find the perimeter.

How: Perimeter is the distance round the shape. Add every side, and do not leave one out.

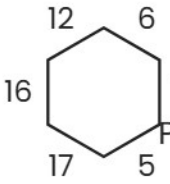

Perimeter: 70

1

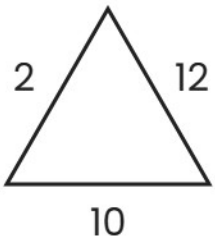

Perimeter: _____

2

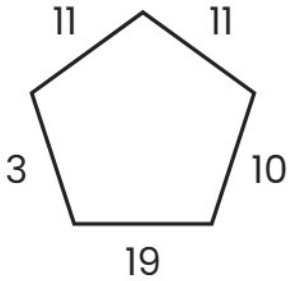

Perimeter: _____

3

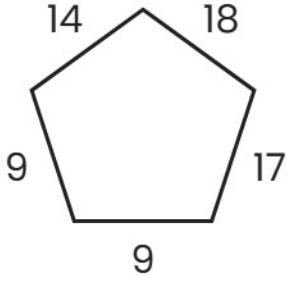

Perimeter: _____

Math Practice - Grade 3

M12 Perimeter, and area versus perimeter - Find the perimeter

M12 3.MD.D.8

Name: _____ Date: _____

Add all the side lengths to find the perimeter.

Example: Add the side lengths to find the perimeter.

How: Perimeter is the distance round the shape. Add every side, and do not leave one out.

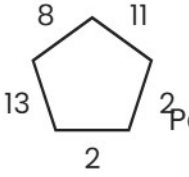

Perimeter: 36

1

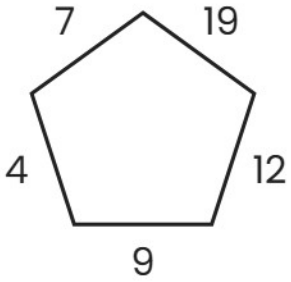

Perimeter: _____

2

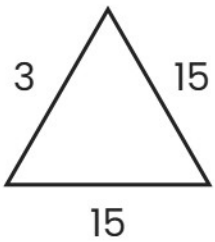

Perimeter: _____

3

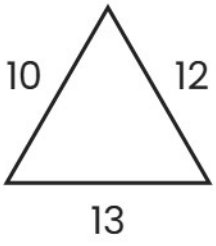

Perimeter: _____

Math Practice - Grade 3

M12 Perimeter, and area versus perimeter - Find the perimeter

M12 3.MD.D.8

Name: _____ Date: _____

Add all the side lengths to find the perimeter.

Example: Add the side lengths to find the perimeter.

How: Perimeter is the distance round the shape. Add every side, and do not leave one out.

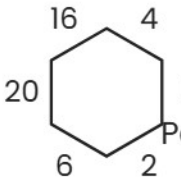

Perimeter: 59

1

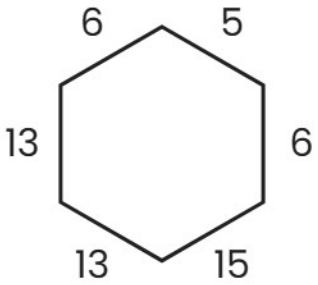

Perimeter: _____

2

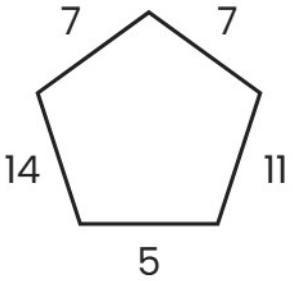

Perimeter: _____

3

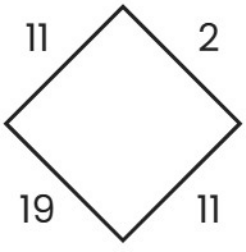

Perimeter: _____