Math Practice - Grade 3

M11 Area - Count unit squares

M11 3.MD.C.5, 3.MD.C.5a, 3.MD.C.5b, 3.MD.C.6, 3.MD.C.7, 3.MD.C.7a, 3.MD.C.7b, 3.MD.C.7c, 3.MD.C.7d

Name: _____ Date: _____

How many unit squares cover the rectangle?

Example: How many unit squares cover the rectangle?

How: Count the squares in one row, then count the rows. Rows times squares in a row is the area.



Squares: 24

1

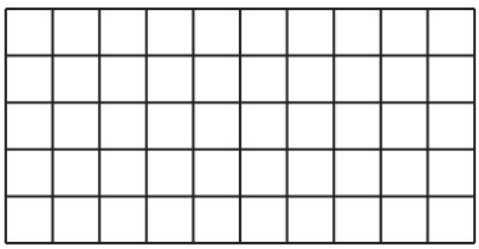

Squares: ____

2



Squares: ____

3



Squares: ____

Math Practice - Grade 3

M11 Area - Count unit squares

M11 3.MD.C.5, 3.MD.C.5a, 3.MD.C.5b, 3.MD.C.6, 3.MD.C.7, 3.MD.C.7a, 3.MD.C.7b, 3.MD.C.7c, 3.MD.C.7d

Name: _____ Date: _____

How many unit squares cover the rectangle?

Example: How many unit squares cover the rectangle?

How: Count the squares in one row, then count the rows. Rows times squares in a row is the area.



Squares: 32

1



Squares: ____

2



Squares: ____

3



Squares: ____

Math Practice - Grade 3

M11 Area - Count unit squares

M11 3.MD.C.5, 3.MD.C.5a, 3.MD.C.5b, 3.MD.C.6, 3.MD.C.7, 3.MD.C.7a, 3.MD.C.7b, 3.MD.C.7c, 3.MD.C.7d

Name: _____ Date: _____

How many unit squares cover the rectangle?

Example: How many unit squares cover the rectangle?

How: Count the squares in one row, then count the rows. Rows times squares in a row is the area.



Squares: 24

1



Squares: ____

2



Squares: ____

3



Squares: ____