Math Practice - Grade 3

M10 Data: scaled graphs and line plots - Scaled graphs

M10 3.MD.B.3, 3.MD.B.4

Name: _____ Date: _____

Read the scaled graph. Answer the question.

Example: How many are there in all?

How: One picture stands for more than one. Count the pictures, then multiply by what one picture stands for.

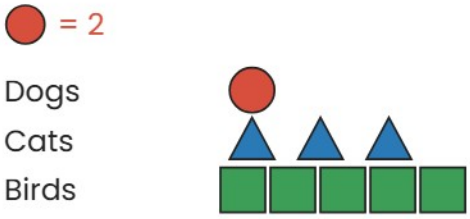

Answer: 18

---

1 **How many fewer Dogs than Birds?**

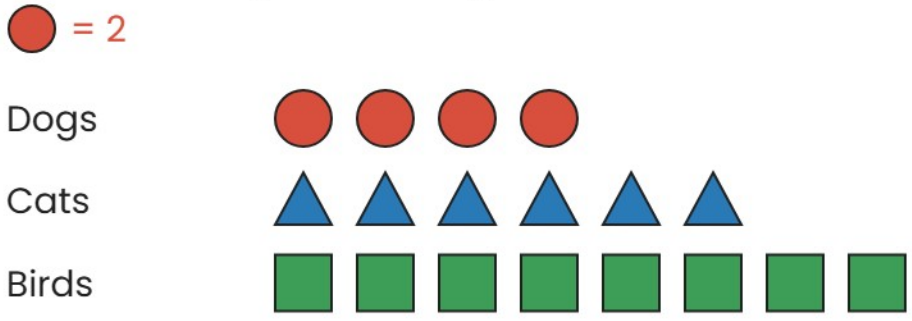

---

2 **How many are there in all?**

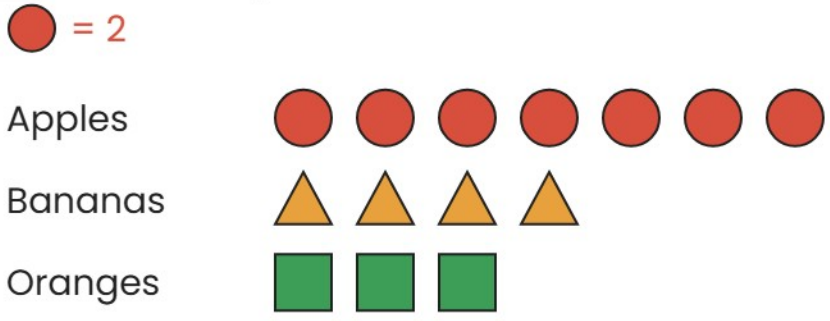

---

3 **How many more Green than Red?**

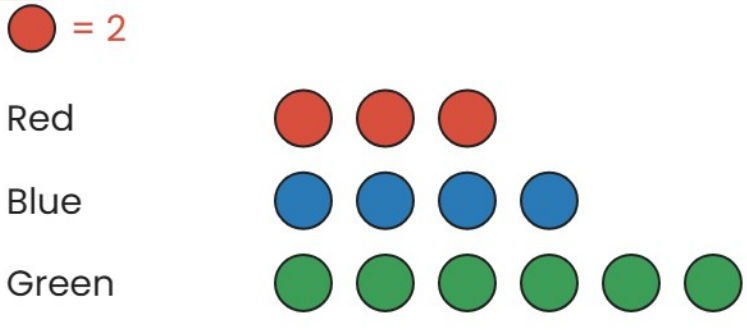

Math Practice - Grade 3

M10 Data: scaled graphs and line plots - Scaled graphs

M10 3.MD.B.3, 3.MD.B.4

Name: _____ Date: _____

Read the scaled graph. Answer the question.

Example: How many more Apples than Oranges?

How: One picture stands for more than one. Count the pictures, then multiply by what one picture stands for.



Answer: 30

---

1 **How many more Oranges than Apples?**

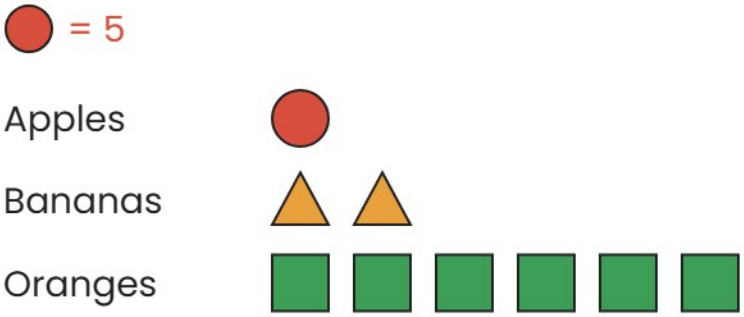

---

2 **How many are there in all?**

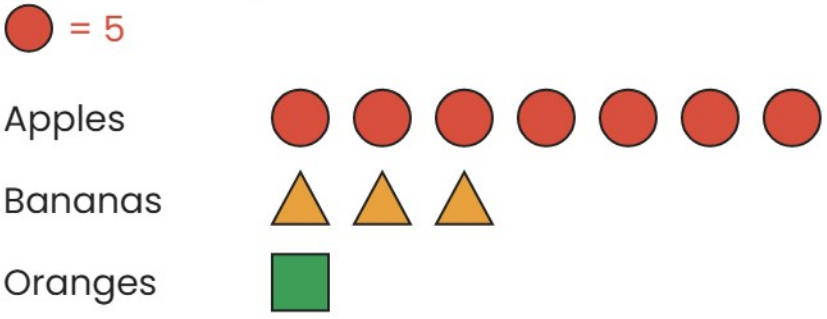

---

3 **How many more Oranges than Bananas?**

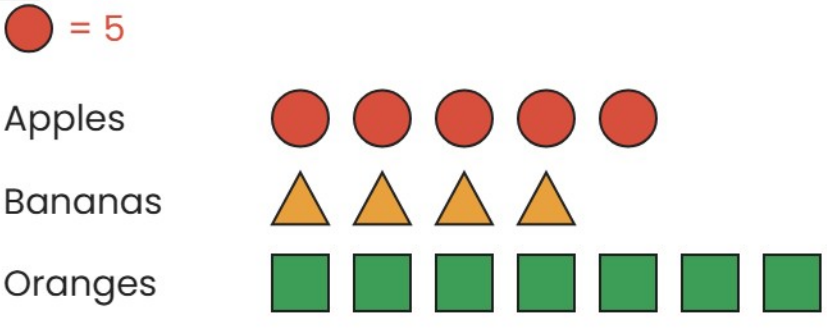

Math Practice - Grade 3

M10 Data: scaled graphs and line plots - Scaled graphs

M10 3.MD.B.3, 3.MD.B.4

Name: _____ Date: _____

Read the scaled graph. Answer the question.

Example: How many fewer Green than Red?

How: One picture stands for more than one. Count the pictures, then multiply by what one picture stands for.

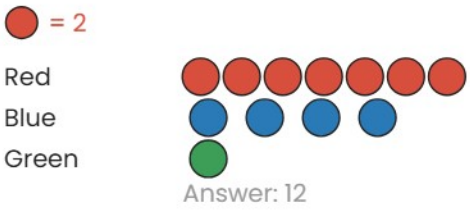

Answer: 12

---

1 **How many fewer Dogs than Birds?**

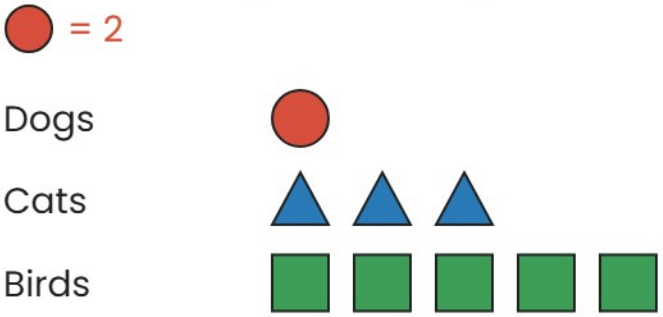

---

2 **How many fewer Blue than Red?**

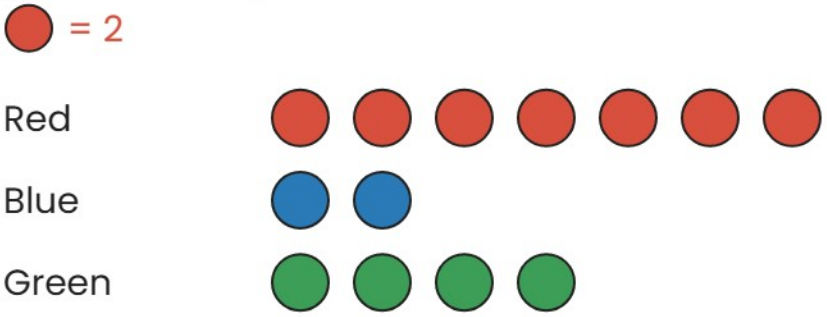

---

3 **How many more Green than Red?**

