# Math Practice - Grade 2

## M9 Money - Count the coins

M9 2.MD.C.8

Name: _____ Date: _____

How much is it in all? Write the total.

**Example: How much is it in all? Write the total.**

How: Start with the biggest coin. Add each coin by its value, not by how many coins there are.

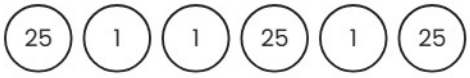


Total: 78¢

---

**1**




Total: _____

---

**2**




Total: _____

---

**3**




Total: _____

# Math Practice - Grade 2

## M9 Money - Count the coins

M9 2.MD.C.8

Name: _____ Date: _____

How much is it in all? Write the total.

**Example: How much is it in all? Write the total.**

How: Start with the biggest coin. Add each coin by its value, not by how many coins there are.




Total: 40¢

---

**1**

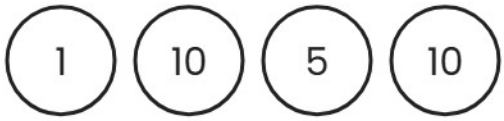


Total: ☐

---

**2**




Total: ☐

---

**3**




Total: ☐

# Math Practice - Grade 2

## M9 Money - Count the coins

M9 2.MD.C.8

Name: _____ Date: _____

How much is it in all? Write the total.

**Example: How much is it in all? Write the total.**

How: Start with the biggest coin. Add each coin by its value, not by how many coins there are.




Total: 3¢

---

**1**




Total: _____

---

**2**




Total: _____

---

**3**

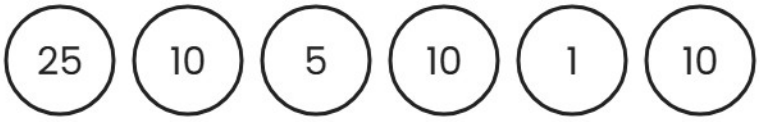


Total: _____