Math Practice - Grade 2

M7 Measuring length and the number line - How much longer

M7 2.MD.A.1, 2.MD.A.2, 2.MD.A.3, 2.MD.A.4, 2.MD.B.5, 2.MD.B.6

Name: _____ Date: _____

How much longer is the red bar than the blue bar?

Example: How much longer is the red bar than the blue bar?

How: Measure both lengths first. Subtract the shorter length from the longer length.



---

1 **How much longer is the red bar than the blue bar?**

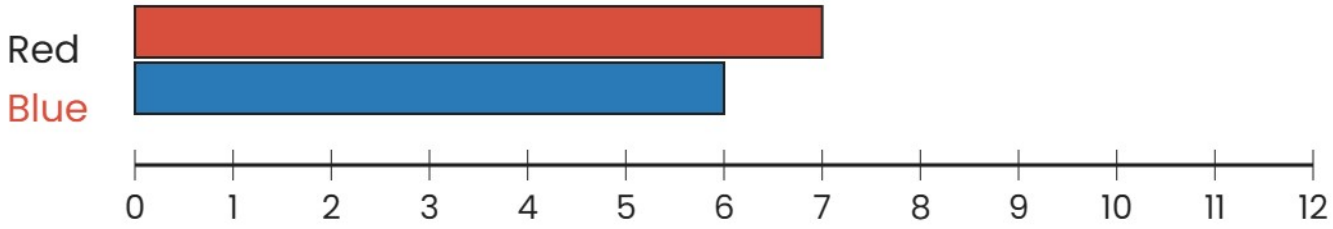

Longer by: ☐

---

2 **How much longer is the red bar than the blue bar?**

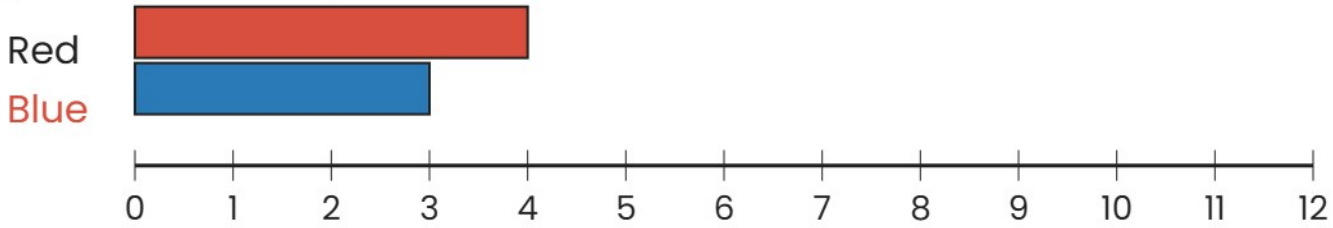

Longer by: ☐

---

3 **How much longer is the red bar than the blue bar?**

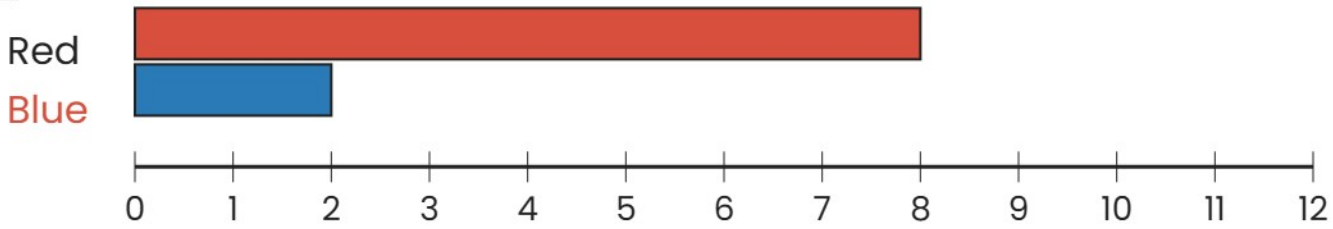

Longer by: ☐

Math Practice - Grade 2

M7 Measuring length and the number line - How much longer

M7 2.MD.A.1, 2.MD.A.2, 2.MD.A.3, 2.MD.A.4, 2.MD.B.5, 2.MD.B.6

Name: _____ Date: _____

How much longer is the red bar than the blue bar?

Example: How much longer is the red bar than the blue bar?

How: Measure both lengths first. Subtract the shorter length from the longer length.

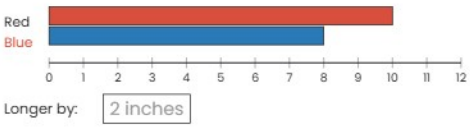

---

1 How much longer is the red bar than the blue bar?

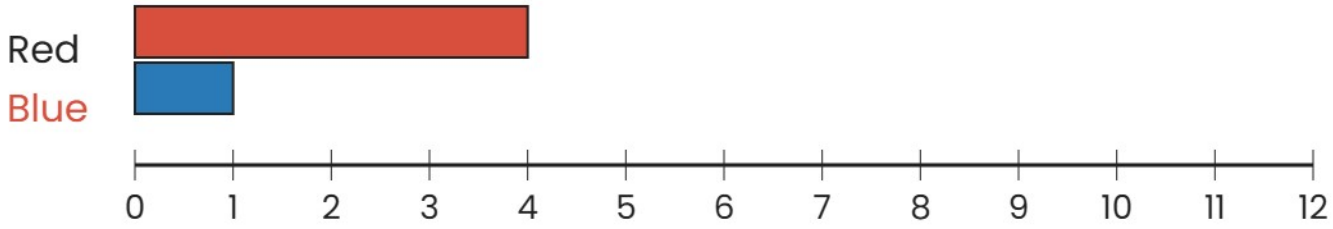

Longer by: ☐

---

2 How much longer is the red bar than the blue bar?

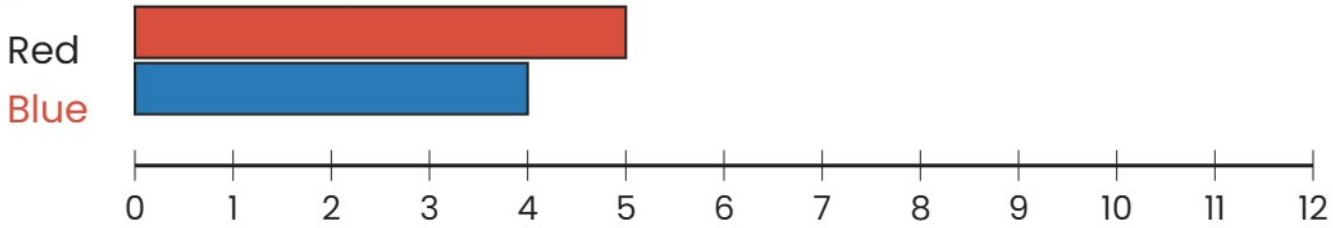

Longer by: ☐

---

3 How much longer is the red bar than the blue bar?

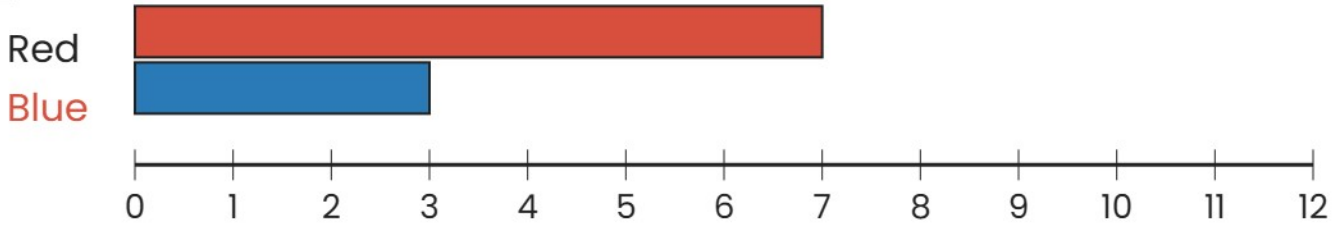

Longer by: ☐

Math Practice - Grade 2

M7 Measuring length and the number line - How much longer

M7 2.MD.A.1, 2.MD.A.2, 2.MD.A.3, 2.MD.A.4, 2.MD.B.5, 2.MD.B.6

Name: _____ Date: _____

How much longer is the red bar than the blue bar?

Example: How much longer is the red bar than the blue bar?

How: Measure both lengths first. Subtract the shorter length from the longer length.

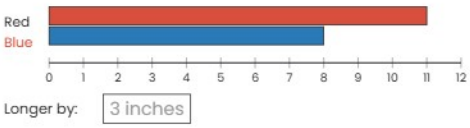

1 How much longer is the red bar than the blue bar?

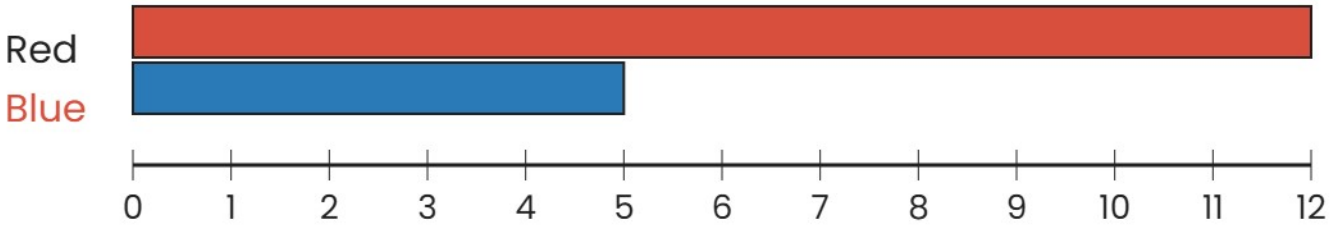

Longer by: ☐

2 How much longer is the red bar than the blue bar?

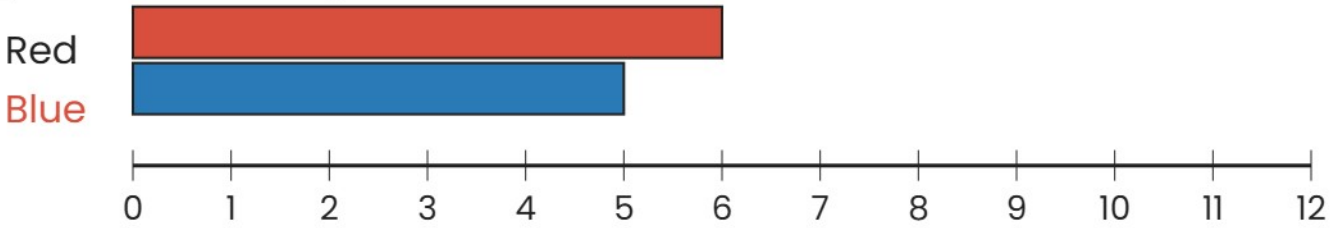

Longer by: ☐

3 How much longer is the red bar than the blue bar?

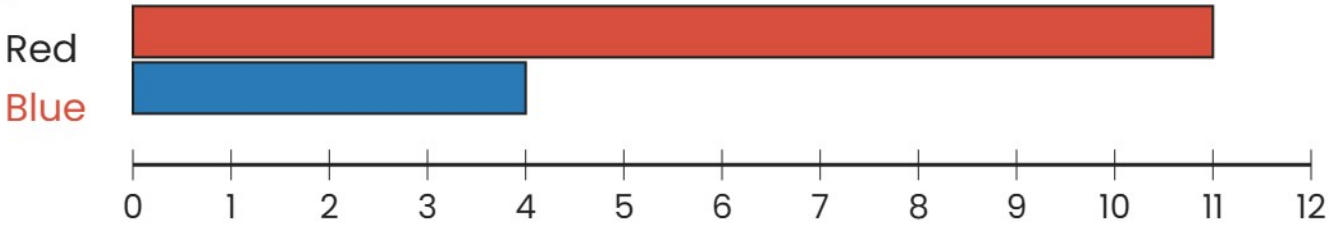

Longer by: ☐