Math Practice - Grade 2

M6 Odd and even, arrays, equal groups - Odd or even

M6 2.OA.C.3, 2.OA.C.4

Name: _____ Date: _____

Pair the dots. Circle Odd or Even.

Example: Pair the dots. Circle Odd or Even.

How: Pair the dots two by two. If every dot has a partner, the number is even. If one dot is left over, the number is odd.



Odd Even

1

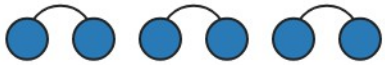

Odd Even

2



Odd Even

3

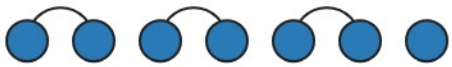

Odd Even

Math Practice - Grade 2

M6 Odd and even, arrays, equal groups - Odd or even

M6 2.OA.C.3, 2.OA.C.4

Name: _____ Date: _____

Pair the dots. Circle Odd or Even.

Example: Pair the dots. Circle Odd or Even.

How: Pair the dots two by two. If every dot has a partner, the number is even. If one dot is left over, the number is odd.



Odd Even

1



Odd Even

2



Odd Even

3

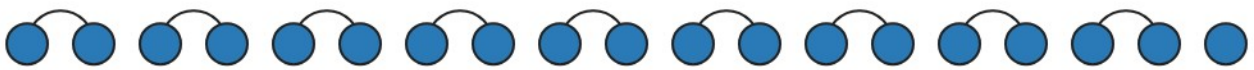

Odd Even

Math Practice - Grade 2

M6 Odd and even, arrays, equal groups - Odd or even

M6 2.OA.C.3, 2.OA.C.4

Name: _____ Date: _____

Pair the dots. Circle Odd or Even.

Example: Pair the dots. Circle Odd or Even.

How: Pair the dots two by two. If every dot has a partner, the number is even. If one dot is left over, the number is odd.



Odd Even

1



Odd Even

2



Odd Even

3



Odd Even