Math Practice - Grade 2

M6 Odd and even, arrays, equal groups - Arrays and equal groups

M6 2.OA.C.3, 2.OA.C.4

Name: _____ Date: _____

Draw the array. Write the repeated addition.

Example: Draw an array with 3 rows and 4 columns.

How: Count the rows first, then count how many are in one row. Write the row size again for each row, then add.



4 + 4 + 4 = 12

---

1 **Draw an array with 5 rows and 4 columns.**

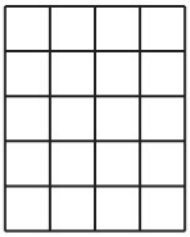

4 + 4 + 4 + 4 + 4 = ☐

---

2 **Draw an array with 3 rows and 2 columns.**

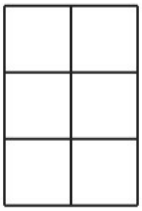

2 + 2 + 2 = ☐

---

3 **Draw an array with 5 rows and 5 columns.**

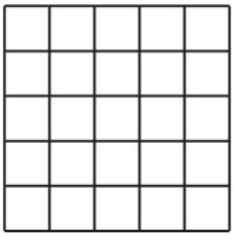

5 + 5 + 5 + 5 + 5 = ☐

Math Practice - Grade 2

M6 Odd and even, arrays, equal groups - Arrays and equal groups

M6 2.OA.C.3, 2.OA.C.4

Name: _____ Date: _____

Draw the array. Write the repeated addition.

Example: Draw an array with 2 rows and 4 columns.

How: Count the rows first, then count how many are in one row. Write the row size again for each row, then add.



4 + 4 = 8

---

1 **Draw an array with 2 rows and 5 columns.**

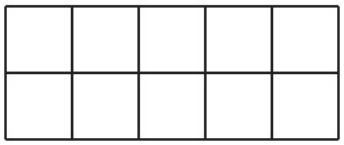

5 + 5 = ☐

---

2 **Draw an array with 4 rows and 5 columns.**

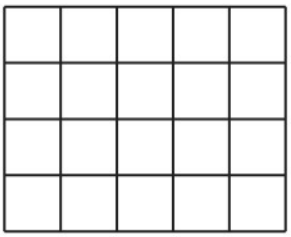

5 + 5 + 5 + 5 = ☐

---

3 **Draw an array with 4 rows and 3 columns.**

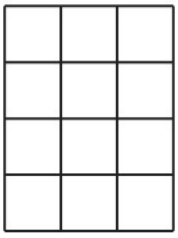

3 + 3 + 3 + 3 = ☐

Math Practice - Grade 2

M6 Odd and even, arrays, equal groups - Arrays and equal groups

M6 2.OA.C.3, 2.OA.C.4

Name: _____ Date: _____

Draw the array. Write the repeated addition.

Example: Draw an array with 2 rows and 3 columns.

How: Count the rows first, then count how many are in one row. Write the row size again for each row, then add.



3 + 3 = 6

---

1 **Draw an array with 5 rows and 2 columns.**



2 + 2 + 2 + 2 + 2 = ☐

---

2 **Draw an array with 3 rows and 5 columns.**

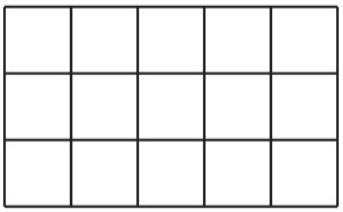

5 + 5 + 5 = ☐

---

3 **Draw an array with 2 rows and 5 columns.**

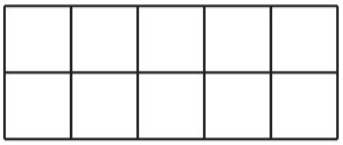

5 + 5 = ☐