# Math Practice - Grade 2

## M11 Shapes, halves, thirds, fourths - Rows and columns of squares

M11 2.G.A.1, 2.G.A.2, 2.G.A.3

Name: _____ Date: _____

How many squares in all?

**Example: The rectangle has 2 rows and 3 columns of squares. How many squares in all?**

How: Count the squares in one row, then count the rows. Add the row again for each row.

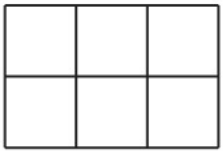

Squares: 6

---

**1** **The rectangle has 4 rows and 4 columns of squares. How many squares in all?**

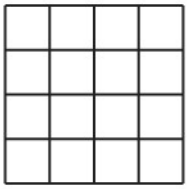

Squares: _____

---

**2** **The rectangle has 4 rows and 3 columns of squares. How many squares in all?**

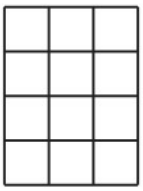

Squares: _____

---

**3** **The rectangle has 3 rows and 5 columns of squares. How many squares in all?**



Squares: _____

# Math Practice - Grade 2

## M11 Shapes, halves, thirds, fourths - Rows and columns of squares

M11 2.G.A.1, 2.G.A.2, 2.G.A.3

Name: _____ Date: _____

How many squares in all?

**Example: The rectangle has 5 rows and 4 columns of squares. How many squares in all?**

How: Count the squares in one row, then count the rows. Add the row again for each row.



Squares: 20

---

**1** **The rectangle has 5 rows and 5 columns of squares. How many squares in all?**

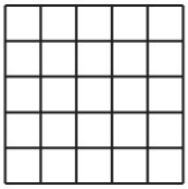

Squares: _____

---

**2** **The rectangle has 4 rows and 3 columns of squares. How many squares in all?**

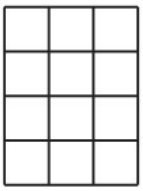

Squares: _____

---

**3** **The rectangle has 2 rows and 5 columns of squares. How many squares in all?**

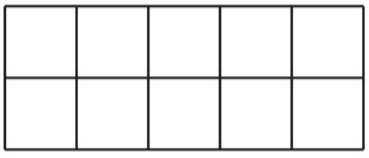

Squares: _____

# Math Practice - Grade 2

## M11 Shapes, halves, thirds, fourths - Rows and columns of squares

M11 2.G.A.1, 2.G.A.2, 2.G.A.3

Name: _____ Date: _____

How many squares in all?

**Example: The rectangle has 5 rows and 2 columns of squares. How many squares in all?**

How: Count the squares in one row, then count the rows. Add the row again for each row.



Squares: 10

---

**1** **The rectangle has 4 rows and 2 columns of squares. How many squares in all?**

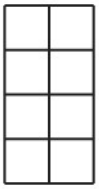

Squares: _____

---

**2** **The rectangle has 4 rows and 3 columns of squares. How many squares in all?**

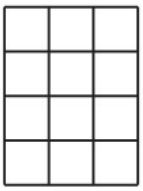

Squares: _____

---

**3** **The rectangle has 3 rows and 3 columns of squares. How many squares in all?**

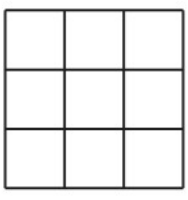

Squares: _____