Math Practice - Grade 2

M11 Shapes, halves, thirds, fourths - Name the shape

M11 2.G.A.1, 2.G.A.2, 2.G.A.3

Name: _____ Date: _____

Name this shape. How many sides? How many angles?

Example: Name this shape. How many sides? How many angles?

How: Name the shape first. Then count its straight sides. Corners are where two sides meet.



Shape: quadrilateral

Sides: 4

Angles: 4

1



Shape: _____

Sides: ☐

Angles: ☐

2



Shape: _____

Sides: ☐

Angles: ☐

3



Shape: _____

Sides: ☐

Angles: ☐

4

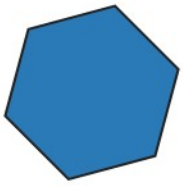

Shape: _____

Sides: ☐

Angles: ☐

Math Practice - Grade 2

M11 Shapes, halves, thirds, fourths - Name the shape

M11 2.G.A.1, 2.G.A.2, 2.G.A.3

Name: _____ Date: _____

Name this shape. How many sides? How many angles?

Example: Name this shape. How many sides? How many angles?

How: Name the shape first. Then count its straight sides. Corners are where two sides meet.



Shape: hexagon

Sides: 6

Angles: 6

1

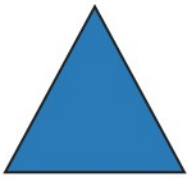

Shape: _____

Sides: ☐

Angles: ☐

2



Shape: _____

Sides: ☐

Angles: ☐

3



Shape: _____

Sides: ☐

Angles: ☐

4



Shape: _____

Sides: ☐

Angles: ☐

Math Practice - Grade 2

M11 Shapes, halves, thirds, fourths - Name the shape

M11 2.G.A.1, 2.G.A.2, 2.G.A.3

Name: _____ Date: _____

Name this shape. How many sides? How many angles?

Example: Name this shape. How many sides? How many angles?

How: Name the shape first. Then count its straight sides. Corners are where two sides meet.



Shape: pentagon

Sides: 5

Angles: 5

1

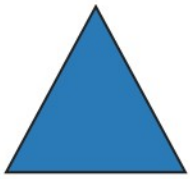

Shape: _____

Sides: ☐

Angles: ☐

2

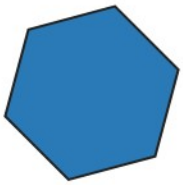

Shape: _____

Sides: ☐

Angles: ☐

3



Shape: _____

Sides: ☐

Angles: ☐

4



Shape: _____

Sides: ☐

Angles: ☐