Math Practice - Grade 2

M10 Data: line plots, picture graphs, bar graphs - Picture graph

M10 2.MD.D.9, 2.MD.D.10

Name: _____ Date: _____

Read the picture graph. Answer the question.

Example: How many in all?

How: Count the pictures in each row. Each picture stands for one thing.

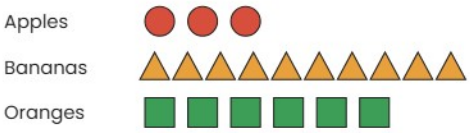

Answer: 19

---

1 **How many in all?**

Apples

Bananas

Oranges

---

2 **Which has the most?**

Apples

Bananas

Oranges

---

3 **Which has the most?**

Apples

Bananas

Oranges

Math Practice - Grade 2

M10 Data: line plots, picture graphs, bar graphs - Picture graph

M10 2.MD.D.9, 2.MD.D.10

Name: _____ Date: _____

Read the picture graph. Answer the question.

Example: How many in all?

How: Count the pictures in each row. Each picture stands for one thing.

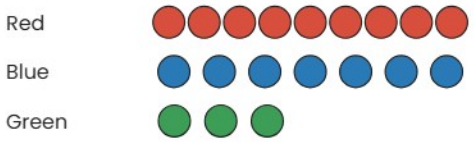

Answer: 19

---

1 **Which has the most?**

Red 

Blue 

Green 

---

2 **Which has the most?**

Apples 

Bananas 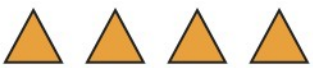

Oranges 

---

3 **Which has the most?**

Apples 

Bananas 

Oranges 

Math Practice - Grade 2

M10 Data: line plots, picture graphs, bar graphs - Picture graph

M10 2.MD.D.9, 2.MD.D.10

Name: _____ Date: _____

Read the picture graph. Answer the question.

Example: How many more Oranges than Apples?

How: Count the pictures in each row. Each picture stands for one thing.

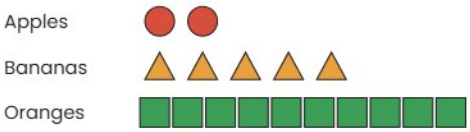

Answer: 8

---

1 **How many more Bananas than Oranges?**

Apples

Bananas

Oranges

---

2 **Which has the most?**

Red

Blue

Green

---

3 **Which has the most?**

Dogs

Cats

Birds