Math Practice - Grade 1

M9 Time to the hour and half hour, and data - Match the time

M9 1.MD.B.3, 1.MD.C.4

Name: _____ Date: _____

Circle the digital time that matches the clock.

Example: Circle the digital time that matches the clock.

How: Read the clock first. Then look at the three times and circle the one that says the same time.



6:00 | 1:30 | 4:00

1



5:30 | 8:30 | 1:00

2



6:00 | 8:30 | 4:00

3



10:30 | 12:30 | 9:30

Math Practice - Grade 1

M9 Time to the hour and half hour, and data - Match the time

M9 1.MD.B.3, 1.MD.C.4

Name: _____ Date: _____

Circle the digital time that matches the clock.

Example: Circle the digital time that matches the clock.

How: Read the clock first. Then look at the three times and circle the one that says the same time.



10:00 | 3:00 | 11:30

1



5:30 | 7:00 | 4:30

2



12:00 | 2:30 | 7:00

3



8:30 | 2:00 | 9:00

Math Practice - Grade 1

M9 Time to the hour and half hour, and data - Match the time

M9 1.MD.B.3, 1.MD.C.4

Name: _____ Date: _____

Circle the digital time that matches the clock.

Example: Circle the digital time that matches the clock.

How: Read the clock first. Then look at the three times and circle the one that says the same time.



10:30 | 3:30 | 1:00

1



6:00 | 8:30 | 7:00

2



6:30 | 3:00 | 2:00

3



7:00 | 9:30 | 11:30