Math Practice - Grade 1

M8 Measure length - Order by length

M8 1.MD.A.1, 1.MD.A.2

Name: _____ Date: _____

Write 1, 2, 3 next to the bars, from shortest to longest.

Example: Write 1, 2, 3 next to the bars, from shortest to longest.

How: Line the bars up at the left. The shortest bar is 1, the middle bar is 2, and the longest bar is 3.

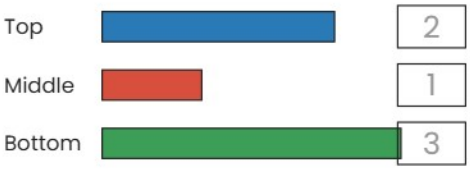

1

Top

Middle

Bottom



2

Top

Middle

Bottom

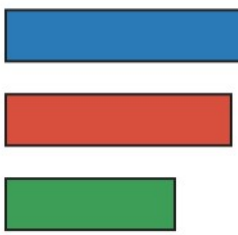

3

Top

Middle

Bottom



4

Top

Middle

Bottom

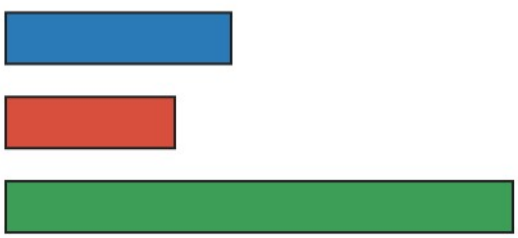

Math Practice - Grade 1

M8 Measure length - Order by length

M8 1.MD.A.1, 1.MD.A.2

Name: _____ Date: _____

Write 1, 2, 3 next to the bars, from shortest to longest.

Example: Write 1, 2, 3 next to the bars, from shortest to longest.

How: Line the bars up at the left. The shortest bar is 1, the middle bar is 2, and the longest bar is 3.

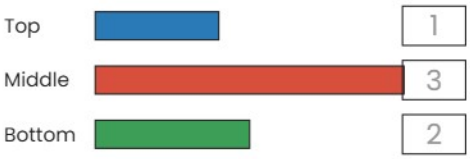

1

Top

Middle

Bottom

2

Top

Middle

Bottom

3

Top

Middle

Bottom

4

Top

Middle

Bottom

Math Practice - Grade 1

M8 Measure length - Order by length

M8 1.MD.A.1, 1.MD.A.2

Name: _____ Date: _____

Write 1, 2, 3 next to the bars, from shortest to longest.

Example: Write 1, 2, 3 next to the bars, from shortest to longest.

How: Line the bars up at the left. The shortest bar is 1, the middle bar is 2, and the longest bar is 3.

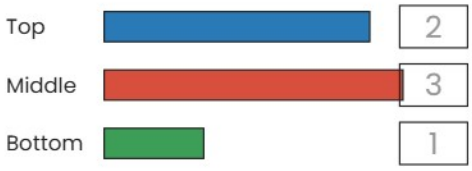

1

Top

Middle

Bottom

2

Top

Middle

Bottom

3

Top

Middle

Bottom

4

Top

Middle

Bottom