Math Practice - Grade 1

M8 Measure length - Measure with units

M8 1.MD.A.1, 1.MD.A.2

Name: _____ Date: _____

How many units long is the bar?

Example: How many units long is the bar?

How: Count the unit squares under the bar. Each square is one unit, and the bar must be covered with no gaps.



Units: 3

1

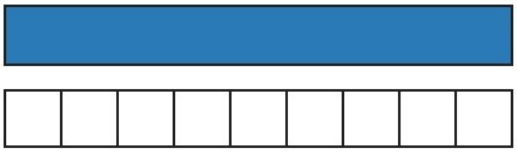

Units: ☐

2

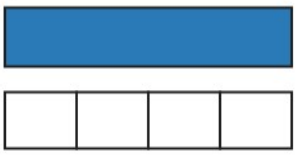

Units: ☐

3

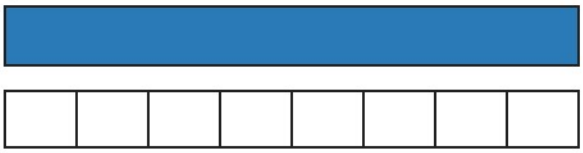

Units: ☐

4

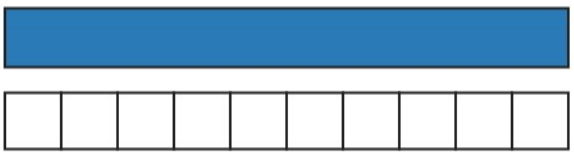

Units: ☐

Math Practice - Grade 1

M8 Measure length - Measure with units

M8 1.MD.A.1, 1.MD.A.2

Name: _____ Date: _____

How many units long is the bar?

Example: How many units long is the bar?

How: Count the unit squares under the bar. Each square is one unit, and the bar must be covered with no gaps.



Units: 5

1

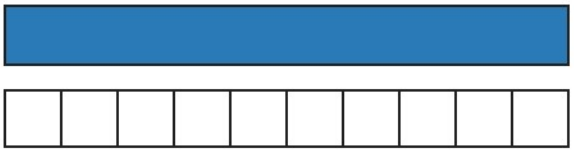

Units: ☐

2

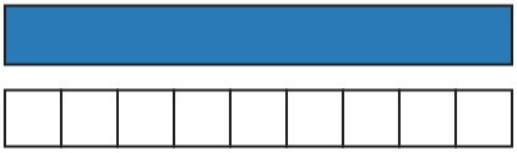

Units: ☐

3

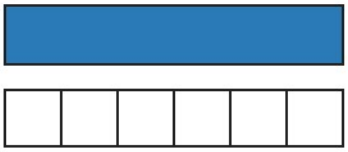

Units: ☐

4

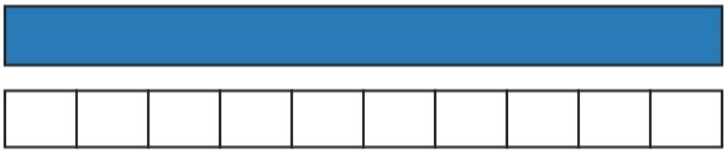

Units: ☐

Math Practice - Grade 1

M8 Measure length - Measure with units

M8 1.MD.A.1, 1.MD.A.2

Name: _____ Date: _____

How many units long is the bar?

Example: How many units long is the bar?

How: Count the unit squares under the bar. Each square is one unit, and the bar must be covered with no gaps.



1

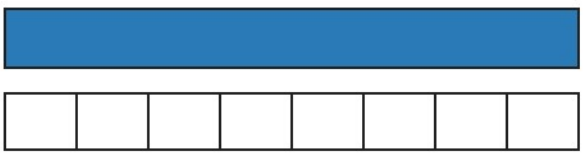

Units: ☐

2

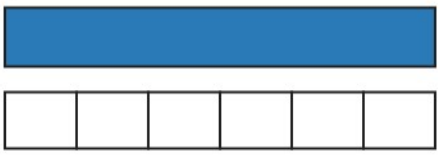

Units: ☐

3

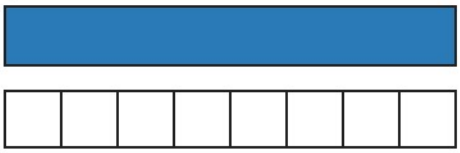

Units: ☐

4

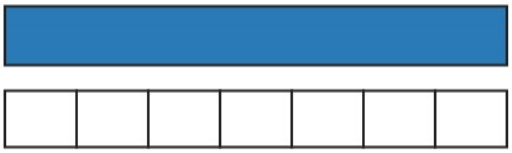

Units: ☐