Math Practice - Grade 1

M4 Add and subtract within 20, make a ten - Make a ten

M4 1.OA.C.6, 1.OA.B.3

Name: _____ Date: _____

Make a ten. Write the answer in the box.

Example: Make a ten. What is 7 + 8?

How: Fill the ten frame to 10 first. The dots left over are added to 10.

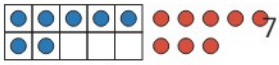

1

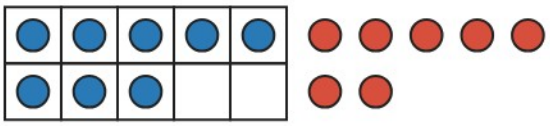

8 + 7 = ☐

2

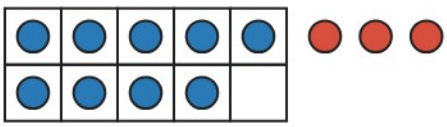

9 + 3 = ☐

3

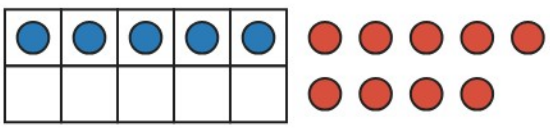

5 + 9 = ☐

4

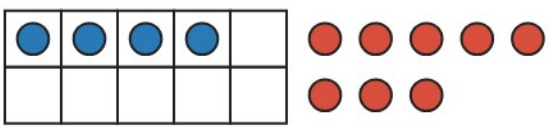

4 + 8 = ☐

Math Practice - Grade 1

M4 Add and subtract within 20, make a ten - Make a ten

M4 1.OA.C.6, 1.OA.B.3

Name: _____ Date: _____

Make a ten. Write the answer in the box.

Example: Make a ten. What is 6 + 7?

How: Fill the ten frame to 10 first. The dots left over are added to 10.

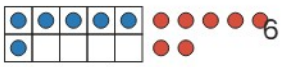

1

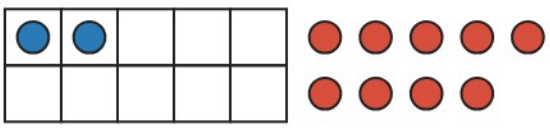

2 + 9 = ☐

2

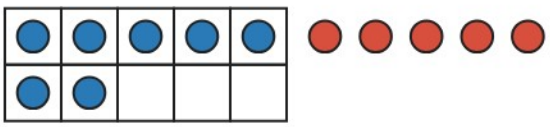

7 + 5 = ☐

3

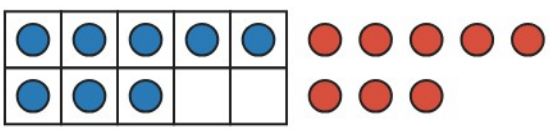

8 + 8 = ☐

4

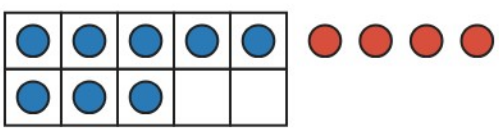

8 + 4 = ☐

Math Practice - Grade 1

M4 Add and subtract within 20, make a ten - Make a ten

M4 1.OA.C.6, 1.OA.B.3

Name: _____ Date: _____

Make a ten. Write the answer in the box.

Example: Make a ten. What is 2 + 9?

How: Fill the ten frame to 10 first. The dots left over are added to 10.

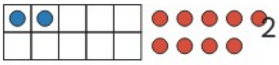

1

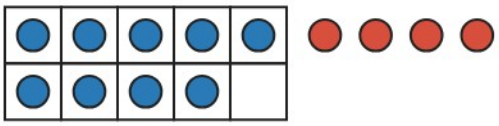

9 + 4 = ☐

2

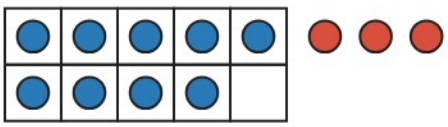

9 + 3 = ☐

3

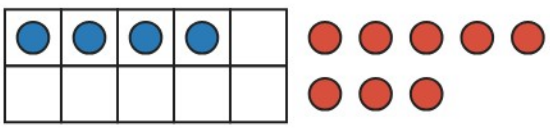

4 + 8 = ☐

4

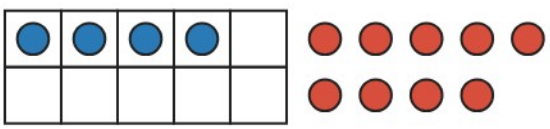

4 + 9 = ☐