Math Practice - Grade 1

M10 Shapes, halves, and fourths - Name the shape

M10 1.G.A.1, 1.G.A.2, 1.G.A.3

Name: _____ Date: _____

Name this shape. How many sides? How many corners?

Example: Name this shape. How many sides? How many corners?

How: Count the straight edges for the sides. Corners are where two sides meet.



Shape: Rectangle

Sides: 4

Corners: 4

1

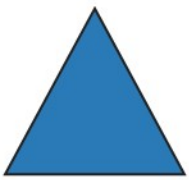

Shape: _____

Sides: ☐

Corners: ☐

2



Shape: _____

Sides: ☐

Corners: ☐

3



Shape: _____

Sides: ☐

Corners: ☐

4



Shape: _____

Sides: ☐

Corners: ☐

Math Practice - Grade 1

M10 Shapes, halves, and fourths - Name the shape

M10 1.G.A.1, 1.G.A.2, 1.G.A.3

Name: _____ Date: _____

Name this shape. How many sides? How many corners?

Example: Name this shape. How many sides? How many corners?

How: Count the straight edges for the sides. Corners are where two sides meet.



Shape: Rectangle

Sides: 4

Corners: 4

1

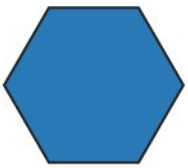

Shape: _____

Sides: ☐

Corners: ☐

2

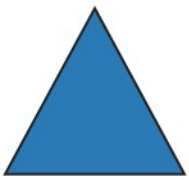

Shape: _____

Sides: ☐

Corners: ☐

3



Shape: _____

Sides: ☐

Corners: ☐

4



Shape: _____

Sides: ☐

Corners: ☐

Math Practice - Grade 1

M10 Shapes, halves, and fourths - Name the shape

M10 1.G.A.1, 1.G.A.2, 1.G.A.3

Name: _____ Date: _____

Name this shape. How many sides? How many corners?

Example: Name this shape. How many sides? How many corners?

How: Count the straight edges for the sides. Corners are where two sides meet.



Shape: Hexagon

Sides: 6

Corners: 6

1



Shape: _____

Sides: ☐

Corners: ☐

2

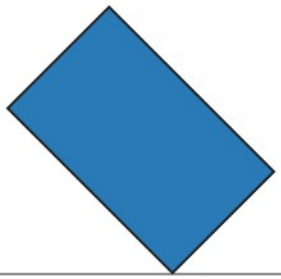

Shape: _____

Sides: ☐

Corners: ☐

3



Shape: _____

Sides: ☐

Corners: ☐

4



Shape: _____

Sides: ☐

Corners: ☐